QUIZIZZ Worksheets

Fraction Quiz
Total questions: 15
Worksheet time: 18mins
Instructor name: Phub Dorji

Name

Class

Date

1. **What fraction is represented by 0.75?**

a) $\frac{75}{10}$

b) $\frac{1}{2}$

c) $\frac{15}{25}$

d) $\frac{3}{4}$

2. 

Which of the following does NOT represent the fraction shown on the left?

a) 2.75

b) $\frac{11}{12}$

c) $\frac{11}{4}$

d) $2\frac{3}{4}$

3. **Pema spent $\frac{4}{5}$ hour in reading story books, $\frac{1}{5}$ hour in writing homework and $\frac{3}{5}$ hour in playing games. What is the total time he spent?**

a) $1\frac{2}{5}$

b) $1\frac{4}{5}$

c) $1\frac{3}{5}$

d) $1\frac{1}{5}$

LIVEWORKSHEETS

4. **Dorji, Tashi and Dawa bought a cake. Dorji ate $\frac{1}{3}$ of the cake, Tashi and Dawa ate $\frac{1}{4}$ of the cake each. How much pizza is left ?**

a) $\frac{1}{2}$

b) $\frac{7}{12}$

c) $\frac{5}{12}$

d) $\frac{1}{6}$

5. 

The shaded portion given on the left can be written as__

a) $\frac{4}{12}$

b) $\frac{10}{12}$

c) $\frac{4}{6}$

d) $\frac{10}{6}$

6. **Pema and Dema had identical chocolate bars. Pema ate $\frac{3}{4}$ of his chocolate bar. Dema ate more of her chocolate bar than Pema. What fraction of her chocolate bar could Dema have eaten?**

a) $\frac{2}{3}$

b) $\frac{3}{5}$

c) $\frac{4}{6}$

d) $\frac{4}{5}$

LIVEWORKSHEETS

7. **Which of the following fractions are correctly arranged in ascending order?**

a) $\frac{4}{8} < \frac{2}{5} < \frac{3}{5}$

b) $\frac{2}{5} < \frac{4}{8} < \frac{3}{5}$

c) $\frac{3}{5} < \frac{4}{8} < \frac{2}{5}$

d) $\frac{2}{5} < \frac{3}{5} < \frac{4}{8}$

8. **Which amongst the following is the greatest?**

a) $\frac{3}{4}$

b) 0.25

c) 0.5

d) $\frac{1}{4}$

9.



Which of the following is represented by the model on the left?

a) $\frac{3}{5} + \frac{1}{10} = \frac{5}{10}$

b) $\frac{3}{5} + \frac{5}{10} = \frac{1}{10}$

c) $\frac{3}{5} - \frac{1}{10} = \frac{5}{10}$

d) $\frac{5}{10} - \frac{1}{10} = \frac{3}{5}$

10. **What type of fraction is $\frac{21}{15}$?**

a) improper fraction

b) Equivalent fraction

c) Proper fraction

d) Mixed fraction

11. **Which fraction is greater?**

a) $\frac{5}{6}$

b) $\frac{9}{12}$

LIVEWORKSHEETS

12. **Which of the following decimal is equal to 2/25?**

a) 0.80

b) 0.08

13. **How would you find the equivalent fraction?**

a) **Multiplying both numerator and denominator by same number.**

b) **Adding both numerator and denominator by same number.**

14. **Sonam ate $\frac{4}{5}$ of the biscuit and Karma ate $\frac{3}{4}$ of the same biscuit? Who ate more?**

a) Karma

b) Sonam

15. **Which of the following is equivalent to $\frac{12}{24}$?**

a) $\frac{4}{8}$

b) $\frac{5}{12}$

LIVEWORKSHEETS