MATEMÀTIQUES

Calcula quants diners hi ha en cada cas i representa-ho a la Capseta Multiplicativa corresponent.

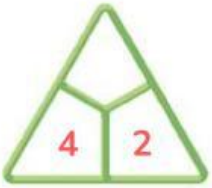

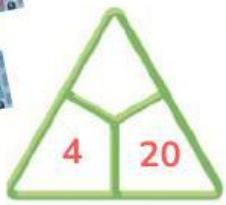

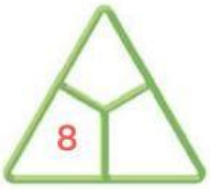

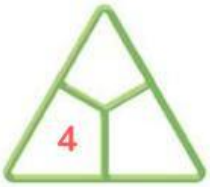

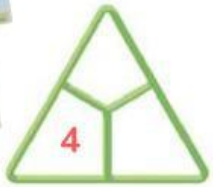

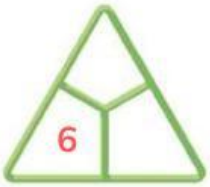

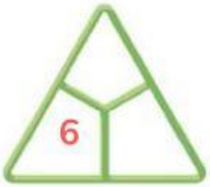

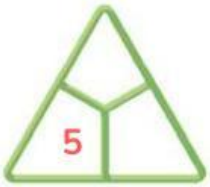

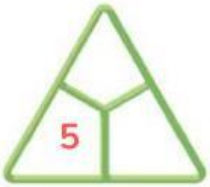

LIVEWORKSHEETS

Completa les capsetes multiplicatives següents:

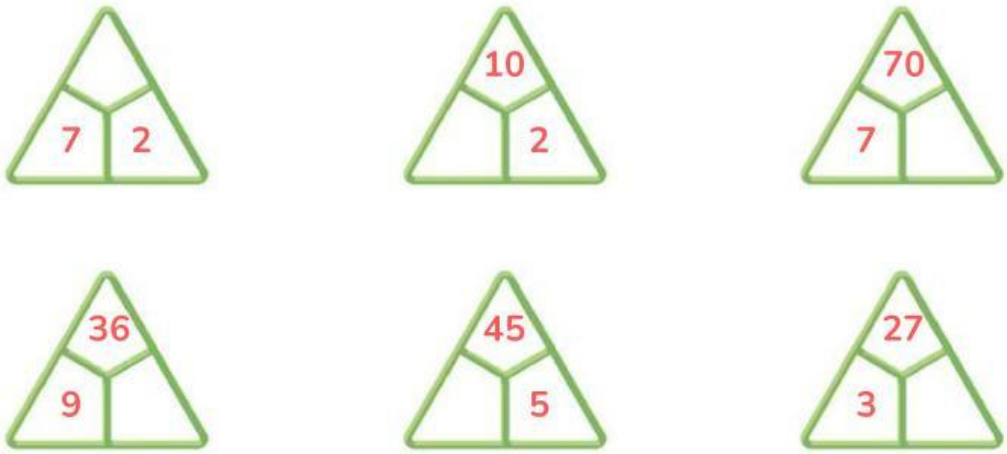

Indica, en cada cas, com representaries aquesta multiplicació i quants quadrats hi ha:



Com representaries aquesta multiplicació?

☐ **20x70** ☐ **7x20** ☐ **20x20**

Quants quadrats hi ha en total?

☐ **14** ☐ **114** ☐ **140**

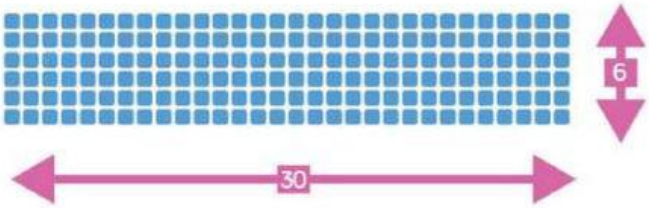

Com representaries aquesta multiplicació?

☐ **30x6** ☐ **3x6** ☐ **36x36**

Quants quadrats hi ha en total?

☐ **118** ☐ **180** ☐ **1800**

LIVEWORKSHEETS