Mathematics

Eighty Family Numbers ED

A. Type the eighty family numbers

B. How many tens and ones?

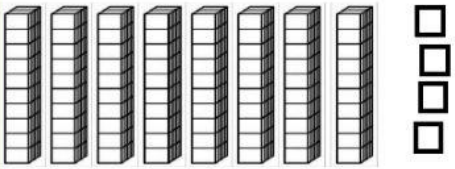

_____tens_____ones =_____

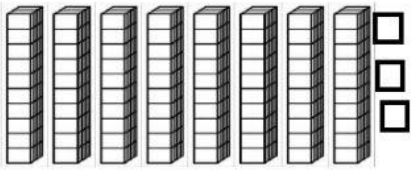

_____tens _____ones =_____

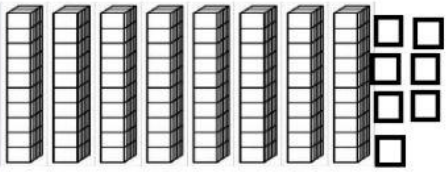

_____tens _____ones =_____

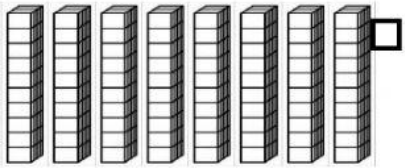

_____tens _____ones =_____

C. Fill in the missing number (before, after, between)

D. _____, 81 E. _____, 89 F. _____, 85

G. 88, _____ H. 80, _____ I. 87, _____

J. 84, _____, 86 K. 87, _____, 89 L. 85, _____, 87

Click the greatest (biggest) number in each set.

(M) 88 81 (N) 80 85 (O) 87 86

P. Which number doesn't belong?

89 80 88 81 87 43

LIVEWORKSHEETS