Leņķi pie 2 taisnēm, ko krusto trešā taisne

Tāpat kā blakusleņķi un krustleņķi, arī **visi šie leņķi ir pa pāriem**: gan iekšējie šķērsleņķi, gan kāpšļu leņķi, gan iekšējie vienpusleņķi.

Iekšējie šķērsleņķi	Iekšējie vienpusleņķi	Kāpšļu leņķi
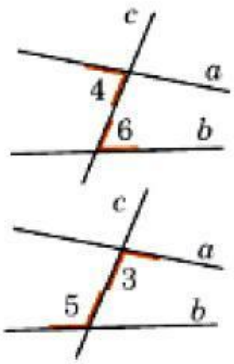	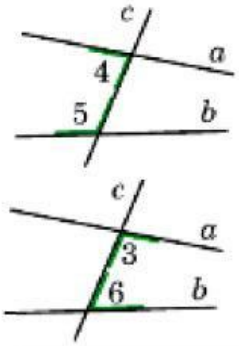	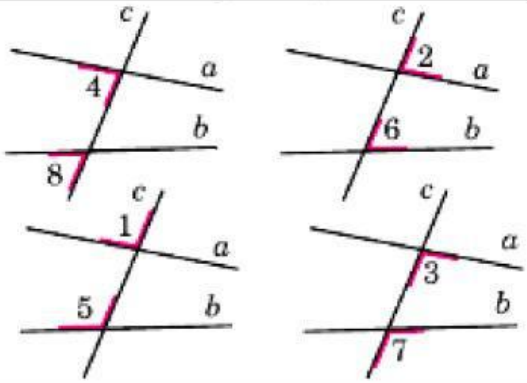
∢4 un ∢6, ∢3 un ∢5	∢4 un ∢5, ∢3 un ∢6	∢4 un ∢8, ∢2 un ∢6, ∢1 un ∢5, ∢3 un ∢7

6.90. Nosauc norādītos leņķus!

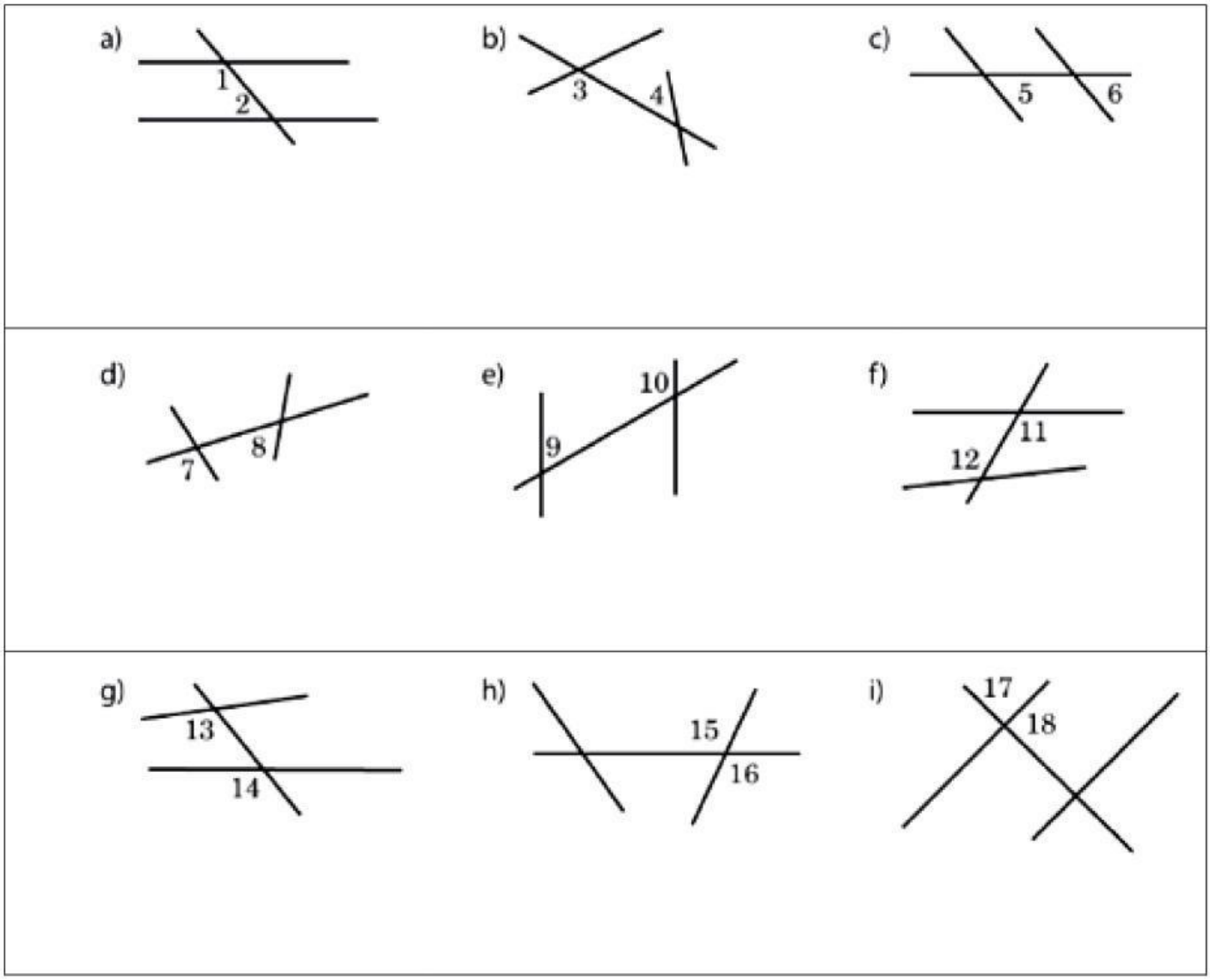

LIVEWORKSHEETS

2. Nosaki leņķa lielumu, ja zināms, ka taisnes *a* un *b* ir paralēlas!

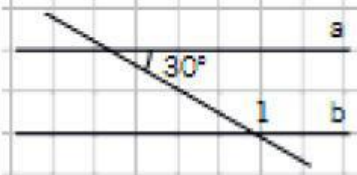

∢1 = ...

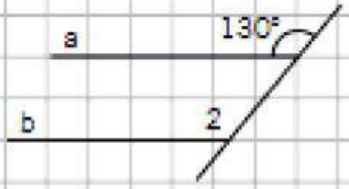

∢2 = ...

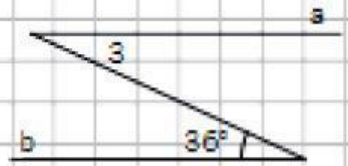

∢3 = ...

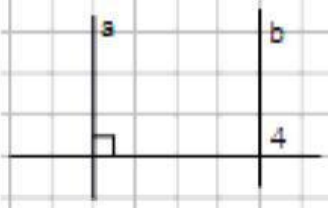

∢4 = ...

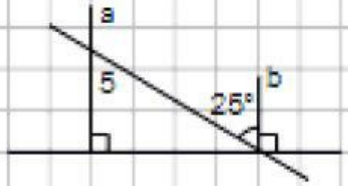

∢5 = ...

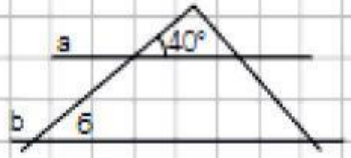

∢6 = ...

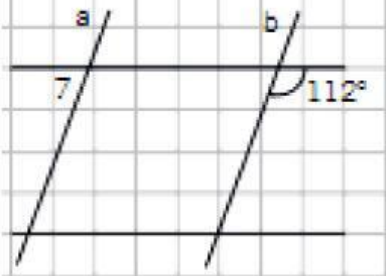

∢7 = ...

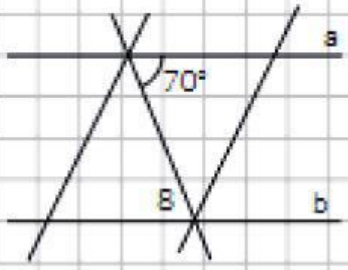

∢8 = ...

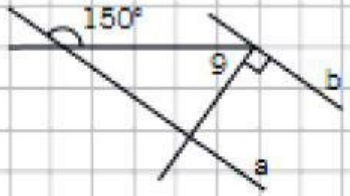

∢9 = ...

3. Aprēķini nezināmos leņķus!

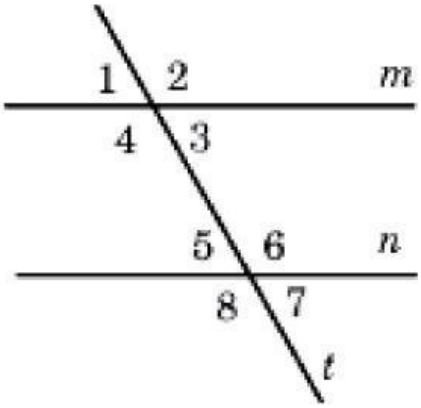

Dots: $m||n$

$< 1 = 40°$

Jāaprēķina: $< 2;\ < 3; < 4;\ < 5;\ < 6;\ < 7;\ < 8$

Aprēķins:

$< 2 =$..... ^{0}

$< 3 =$..... ^{0}

$< 4 =$..... ^{0}

$< 5 =$..... ^{0}

$< 6 =$..... ^{0}

$< 7 =$..... ^{0}

$< 8 =$..... ^{0}

LIVEWORKSHEETS