BÀI TẬP ÔN TẬP

I. Look and match

earth

star

moon

astronaut

sea

land

II. Label and match

sight touch smell taste hearing



_____

_____

_____

smell

_____

_____

III. Label the diagram with ‘ sun, moon, earth’



_____ _____ _____

LIVEWORKSHEETS

IV. Push or pull?

a. _____

b. _____

V. Do they need 'heat and light' from the sun? Look. Write Yes/ No.

1. _____

2. _____

3. _____

4. _____

VI. Color the ☺ for `**healthy food'**, ☹ for **' unhealthy food'**



LIVEWORKSHEETS

VII. What do we need to stay alive? Tick ✓ the corrrect box.



VIII. What can you find in the soil? Color them.

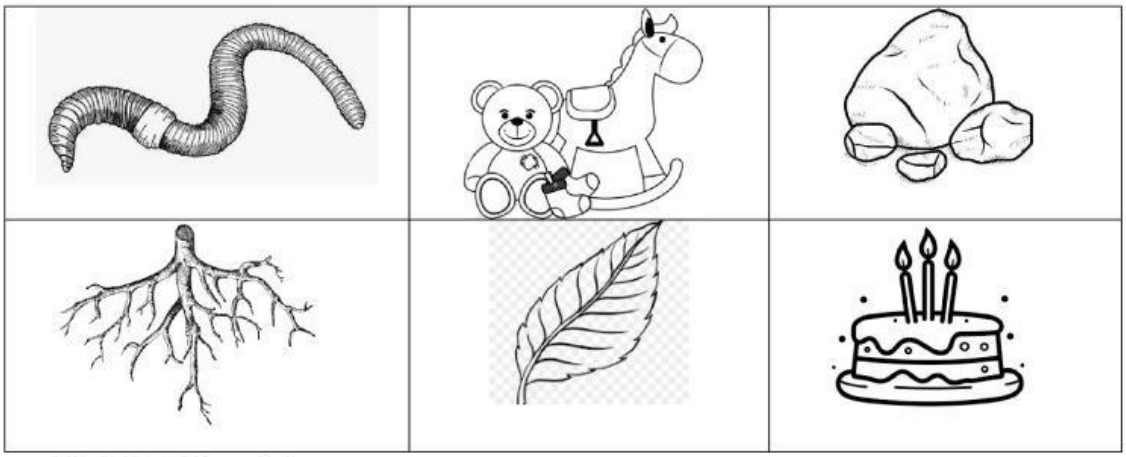

IX. Label the picture



LIVEWORKSHEETS

I. There are 4 children recording their hands' length by bricks. Look at the picture and write answer for the question.

			
Anna	Ben	Leo	Sue
			
Example: 5 bricks	__ bricks	__ bricks	__ bricks

1. How many bricks is **Ben**'s hand? Fill in the table. _____
2. How many bricks is **Leo's**hand? Fill in the table. _____
3. How many bricks is **Sue's** hand? Fill in the table _____
4. How many bricks is **Anna's**hand? Fill in the table _____
5. Who has the **shortest** hand? _____
6. Who has the **longest** hand? _____

- End-

LIVEWORKSHEETS