Name: _____

Directions: Count the objects and find the sum.

1) 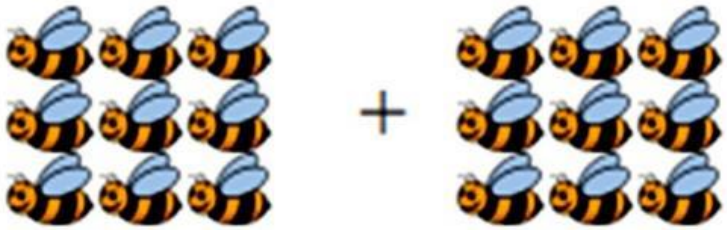 + = ☐

2) + = ☐

3) + = ☐

4) + = ☐

5) + = ☐

6)  + 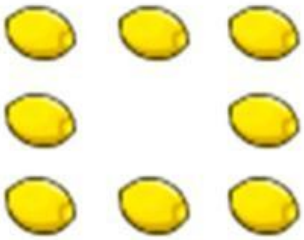 = ☐

LIVEWORKSHEETS

Name: _____

Directions: Count the objects and find the sum.

1. 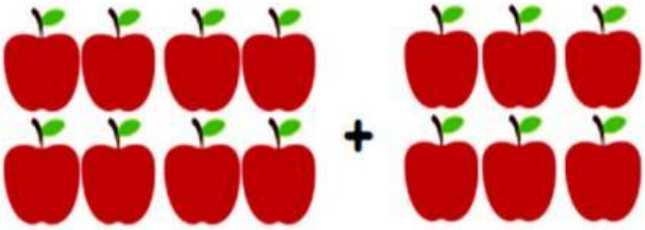 + = _____

2.  +  = _____

3.  +  = _____

4. +  = _____

5.  + = _____

6. + = _____

LIVEWORKSHEETS