نشاط: احسب الطول المجهول للضلع. املأ الفراغات.

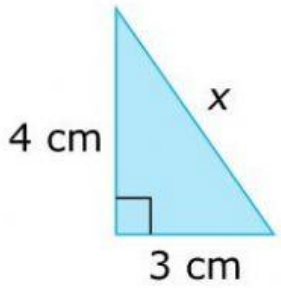

$x =$ ☐ cm

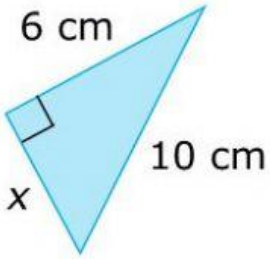

$x =$ ☐ cm

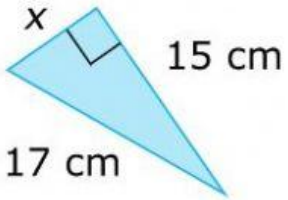

$x =$ ☐ cm

LIVEWORKSHEETS