Nama : .....

Kelas : .....

Bangun Ruang

Pasangkan nama bangun yang sesuai dengan gambar yang diberikan.

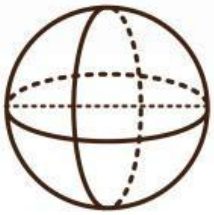

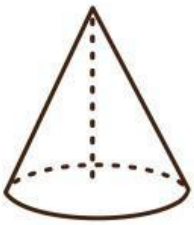

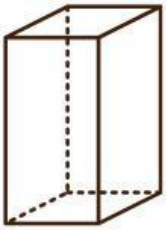

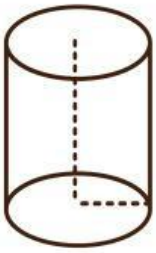

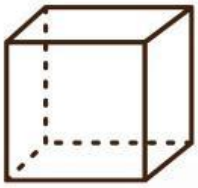

- Kerucut
- Bola
- Kubus
- Balok
- Tabung

LIVEWORKSHEETS