Let's Learn!

Multiplying 2: Skip-counting

1 There are 2 skate scooters in 1 group.

$1 \times 2 = 2$



How many skate scooters are there in 10 groups?

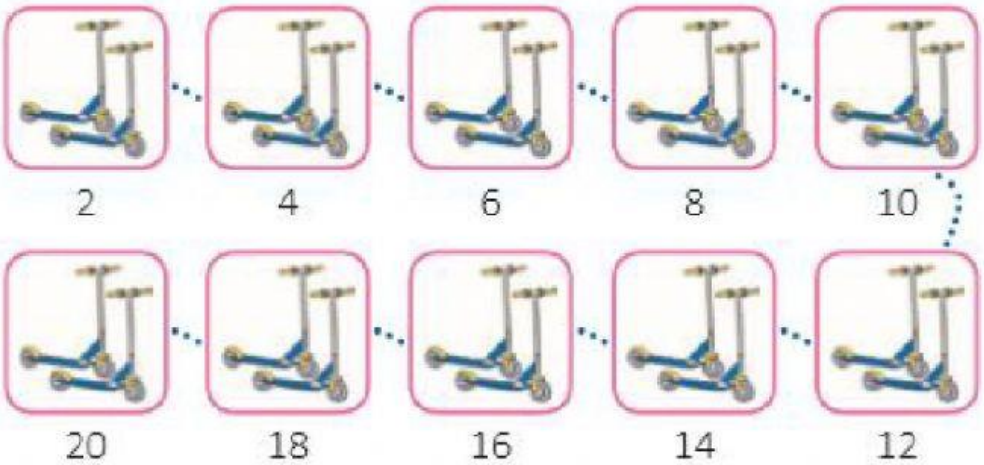

2, 4, 6, 8, 10, 12, 14, 16, 18, 20

$10 \times 2 = 20$

There are 20 skate scooters.

LIVEWORKSHEETS

2 Ali has 7 bags.
There are 2 pineapples in each bag.
How many pineapples does he have altogether?

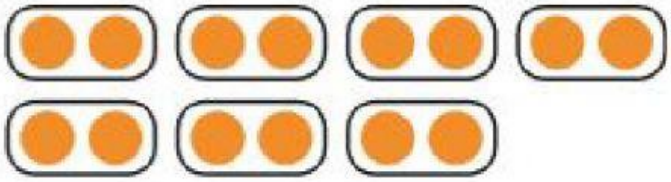



Ali has 14 pineapples altogether.

3 Sarah has 8 jars.
There are 2 guppies in each jar.
How many guppies does Sarah have altogether?

☐ × 2 = ☐



Sarah has ☐ guppies altogether.

LIVEWORKSHEETS