LKPD
GARIS DAN SUDUT

Perhatikan dan simak penjelasan video di bawah ini!

Kemudian kerjakanlah soal-soal di bawah ini dengan tepat!

1.

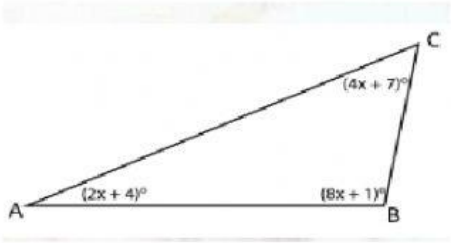

Besar sudut BAC adalah ….

A. 24°

B. 28°

C. 55°

D. 65°

2.

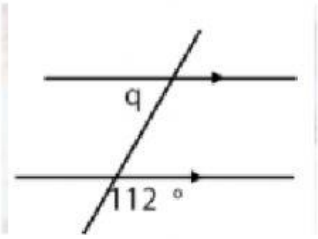

Nilai q adalah ….

A. 68°

B. 55°

C. 48°

D. 35°

3. Tentukan Hubungan antar sudut berikut:

LIVEWORKSHEETS

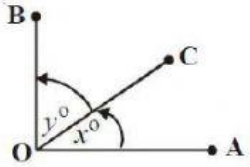

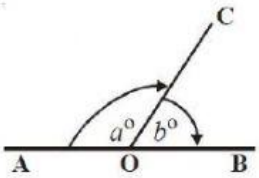

4. Buatlah garis ke jawaban yang tepat!

∠EDF + ∠CDF = 180° (sudut pelurus) 7x + 80° + 3x = 180°	10
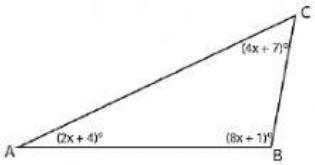 Besar sudut BAC adalah ….	108^0
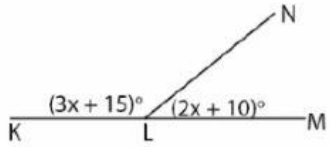 Besar pelurus sudut KLN adalah ….	92^0

5. Hitung nilai x dan pilih jawapan yang betul. Klik dan drag jawapan ke dalam kotak

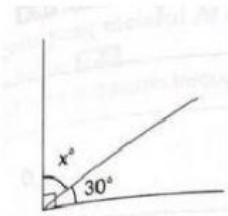

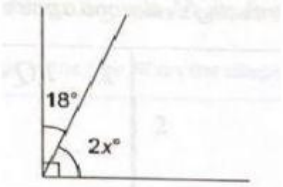

	70^0
	60^0

LIVEWORKSHEETS

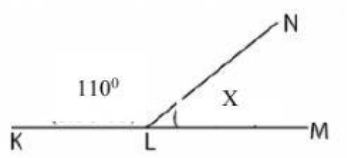

72^0

LIVEWORKSHEETS