INSPIRED TOTS EARLY LEARNING CENTER
PRE K SECOND TERM EXAMINATION 2024

NUMERACY

1. What number is this? _____

2. Identify the numbers in the table below.

10	20	30	40	50
60	70	80	90	100

2. What number is this? _____

4. Count the number of spoons. _____



LIVEWORKSHEETS

5. What number is this? _____

6. select the numbers 18 from the numbers below.

7. What number is this? _____

LIVEWORKSHEETS

8. Identify and select the numbers 19.

19	10	5	19	11
12	13	19	12	19

9. What number is this? _____

10. What shape is this? _____

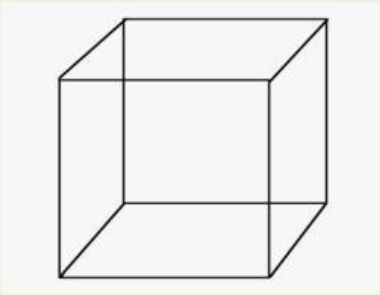

11. What number is this? _____

LIVEWORKSHEETS

12. Match the numbers to the correct pictures.



13. Find the number 12.

12	11	12	13
11	12		12
12			10
13			12
12	11	12	13

LIVEWORKSHEETS

14. What shape is this? _____

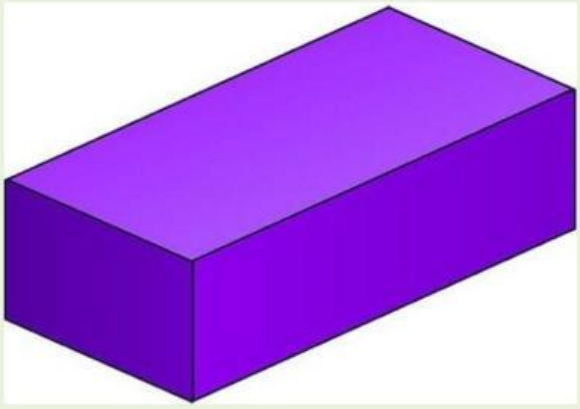

15. What color is this? _____



LIVEWORKSHEETS