Repaso Situación 9

1.Completa y calcula el área.

5 cm

3 cm

A= ☐ x ☐ = ☐ cm^2

4 cm



A= ☐ x ☐ = ☐ cm^2

4 cm

LIVEWORKSHEETS

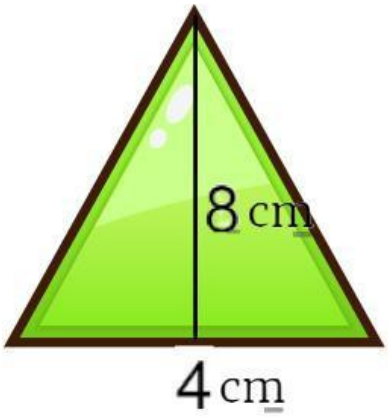

A= (☐ x ☐) / ☐ = ☐ ☐

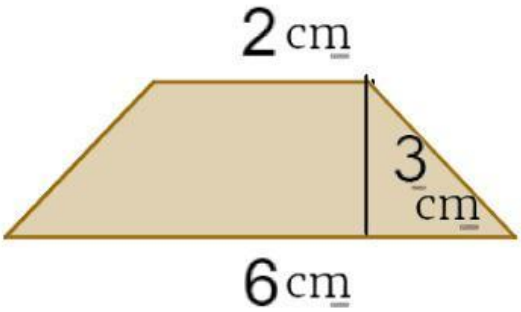

A= ☐ x (☐ + ☐) / ☐ = ☐ ☐

2. Calcula el área y el perímetro.

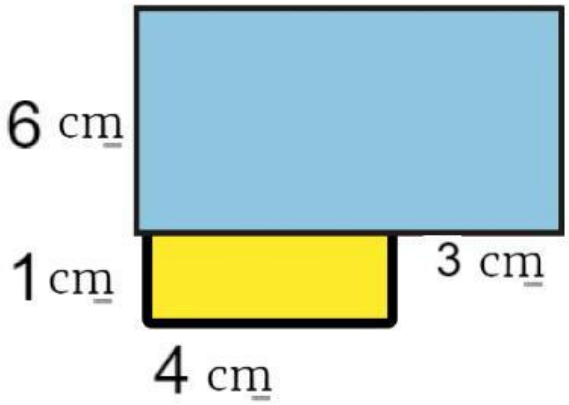

P= ☐ ☐

A= ☐ ☐

LIVEWORKSHEETS

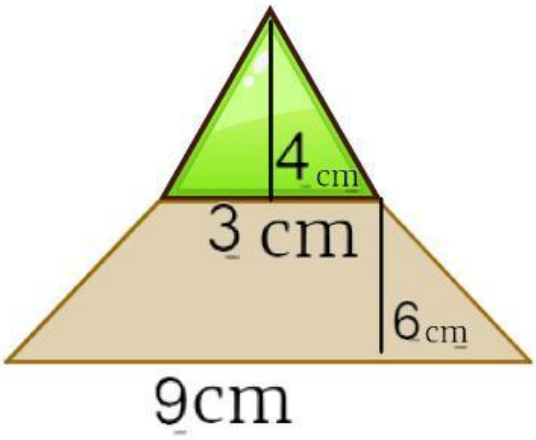

P= ☐ ☐

A= ☐ ☐

3. Calcula el área y el perímetro.



A= ☐

P= ☐

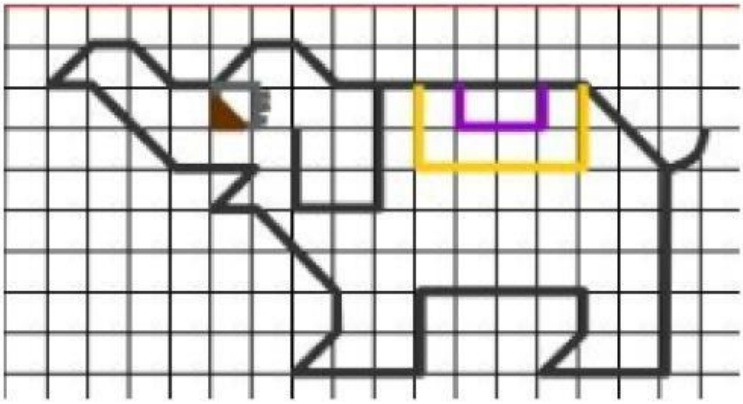

A= ☐

P= ☐

LIVEWORKSHEETS

LIVEWORKSHEETS

LIVEWORKSHEETS