INSPIRED TOTS EARLY LEARNING CENTER
SECOND TERM EXAMINATION 2024

MATHEMATICS CLASS: K5

Answer the following questions.

1. What is a polygon? _____
2. Mention two shapes that are polygons. _____ _____

Correct the mistakes.

44,42, 40,39, 36, 34, 32 _____

50,49, 47, 46, 42, 40,44_____

Compare using less than < or > greater than

84 ____ 79	51 _____ 56	90 ____ 89
63 ____ 68	42 _____ 20	11 ____ 10

Fill in the table appropriately.

SHAPE	SQUARE	RECTANGLE
Number of sides		
Number of corners		
All sides equal (yes/no)		

Answer the following questions.

1. List four solid shapes you know._____
2. How many faces does the cube have? _____
3. What shape is found on the cuboid?_____
4. How many sides does the cuboid have? _____

Count and skip count to find the missing numbers.

a. 40, 50, _____ , _____ , 80, 90

b. 42, _____, 46, _____, _____,

c. 57, _____ _____ _____, 61, 62

Fill up the missing numbers.

LIVEWORKSHEETS

INSPIRED TOTS EARLY LEARNING CENTER
SECOND TERM EXAMINATION 2024

1)

tens	ones

=

2)

tens	ones

=

3) 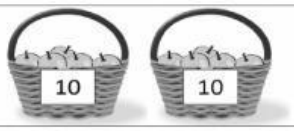

tens	ones

=

4)

tens	ones

=

5)

tens	ones

=

Match these objects and shapes by drawing a line with your ruler from the object to the shape.

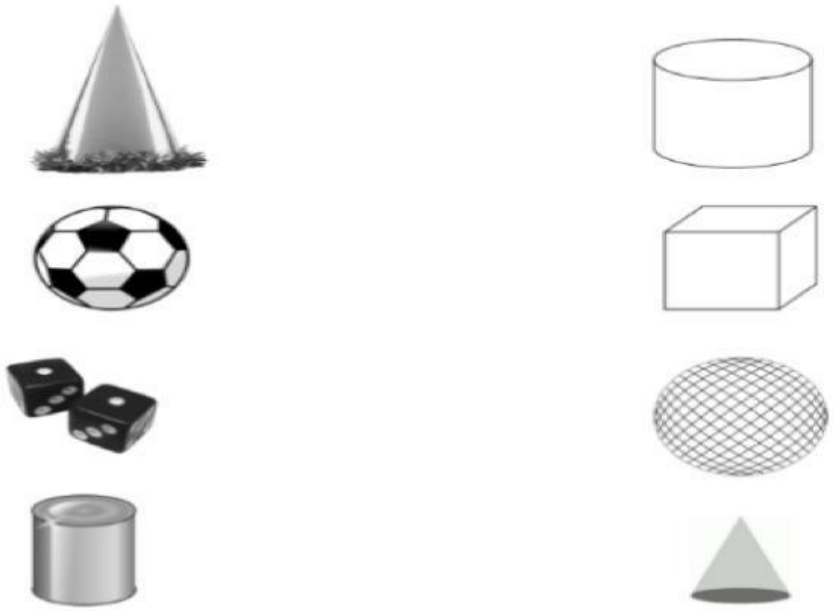

LIVEWORKSHEETS

INSPIRED TOTS EARLY LEARNING CENTER
SECOND TERM EXAMINATION 2024

Complete

a.13 is 10 and 3
b.18 is ___ and ___
c.19 is ___and ____
d. 16 is ____ and _____
e. 15 is ____ and _____
f. 11 is ____ and _____

Draw more to make ten. Finish the addition sentence.

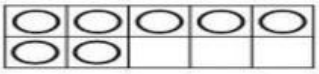 7 + _____ = 10	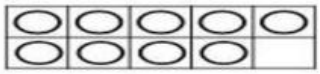 9 + _____ = 10
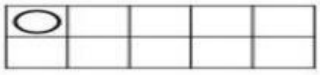 1 + _____ = 10	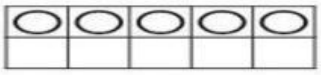 5 + _____ = 10
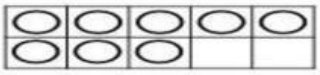 8 + _____ = 10	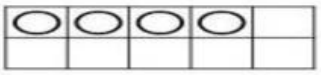 4 + _____ = 10
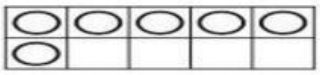 6 + _____ = 10	 2 + _____ = 10

Color the shapes using the key below.

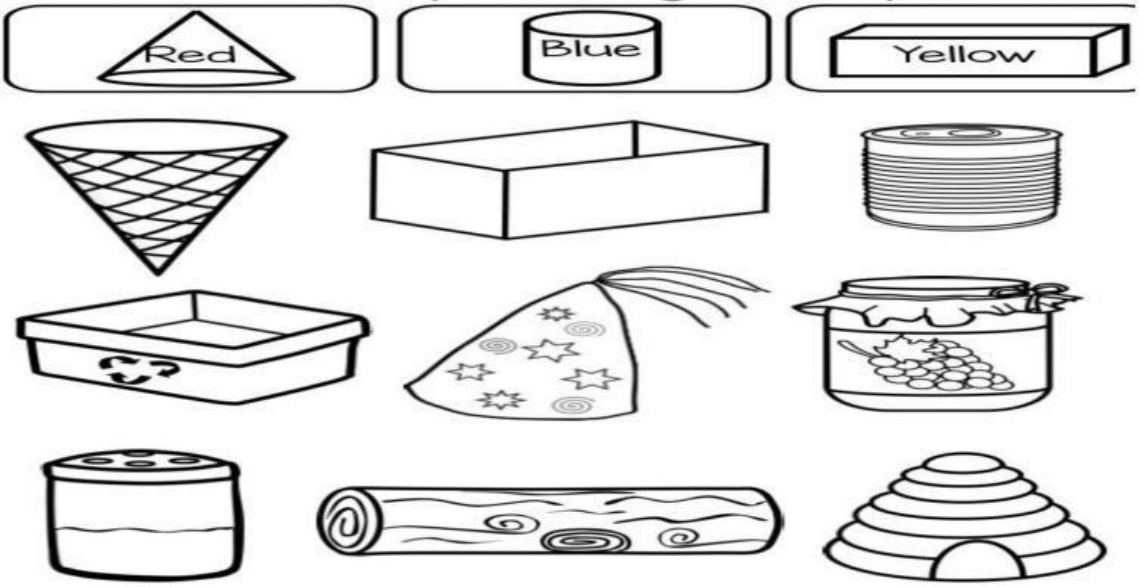

LIVEWORKSHEETS

INSPIRED TOTS EARLY LEARNING CENTER
SECOND TERM EXAMINATION 2024

Cross out (X) the odd object and tell the reason.

Find the sums.

7 + 0 =

1 + 8 =

3 + 5 =

4 + 5 =

7 + 2 =

0 + 6 =

Skip count backwards in 2's and complete the counting pattern.

44, 42, _____, 38, _____, _____, 32

76, _____,72, _____,_____,66, _____

Skip count forwards in 5's and complete.

60, _____, _____, 75, 80, _____, _____

25,30, _____, _____, _____, 50, _____

Skip count to find the missing numbers.

62, 64, 66, _____, 70, 72

13, 23, _____, 43, 53, 63

90, 85, 80, _____, 70, 65

LIVEWORKSHEETS