<u>แบบทดสอบ</u>: ทดลองวางทิศของแรง ($\vec{F}$) กระแส ($\vec{I}$) และสนามแม่เหล็ก ($\vec{B}$) ให้ถูกต้อง

$\vec{I}$

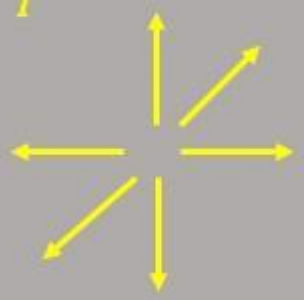

$\vec{B}$

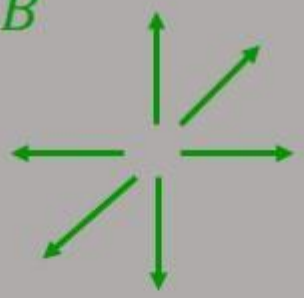

$\vec{F}$

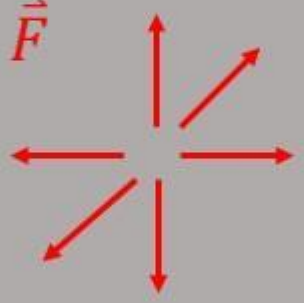

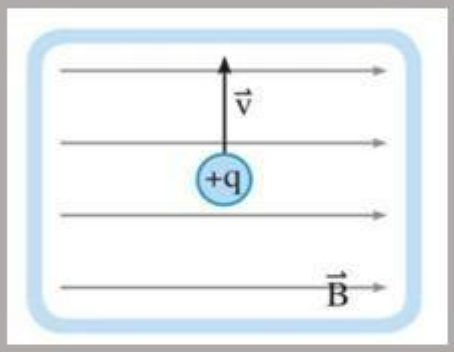

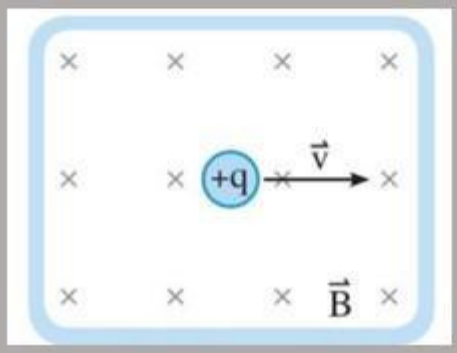

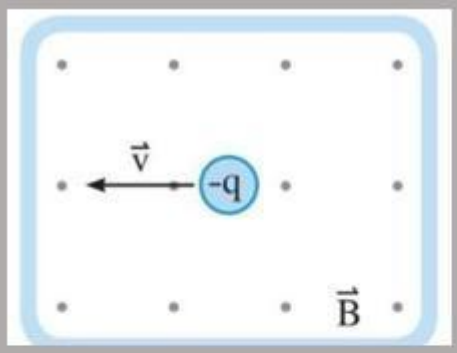

LIVEWORKSHEETS