Volume of liquids and cuboids

Convert each container's capacity milliliters.

0.75L _____mL

2L _____mL

0.25L _____mL

5.75L _____mL

Convert each container's capacity to liters.

0.75ml

_____L

_____ ml

250mL

_____L

5.205L

_____ ml

Total Volume

Calculate the total volume these of containers.

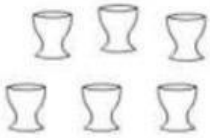

25mL each



total volume =

_____mL

Calculating Volume

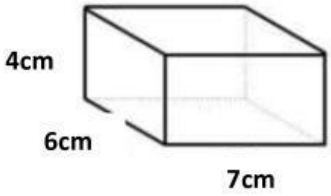

volume =

_____ cm^3

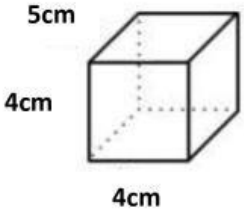

volume =

_____ cm^3

Volume of 3D Stacks

= 1 cm^3

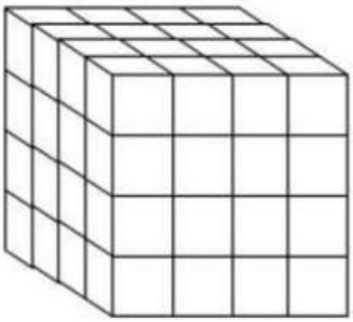

volume =

_____cm^3

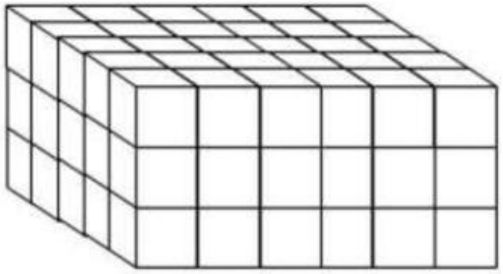

volume =

_____cm^3

LIVEWORKSHEETS