1. A bicycle costs $75.

   A tricycle costs $20 less than the bicycle.

(a) How much does the tricycle cost?

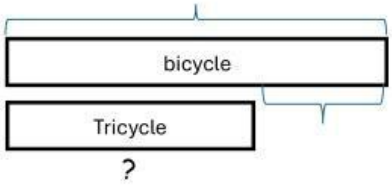

[ ] [-] [ ] = [ ]

(b) How much do the bicycle and the tricycle cost altogether?

[ ] [+] [ ] = [ ]

2. There were 254 girls in a water park.

   There were 56 more boys than girls in the waterpark.

(a) How many boys were there in the waterpark?

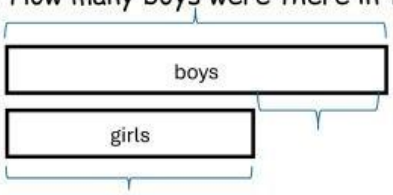

[ ] [+] [ ] = [ ]

(b) How many boys and girls were there in the waterpark?

[ ] [ ] [ ] = [ ]

3. Alyara scored 459 points in a game.

   Alisha scored 400 more points than Alyara.

(a) How many points did Alisha score?

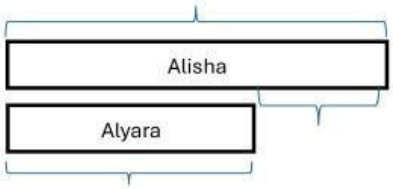

[ ] [+] [ ] = [ ]

(b) How many points did Alyara and Alisha score altogether?

[ ] [ ] [ ] = [ ]

LIVEWORKSHEETS