DIVISIÓN CON DECIMALES

ACTIVIDAD

- Observa el video y luego procede a desarrollar las siguientes divisiones.

1) $0{,}000842 \div 0{,}19$

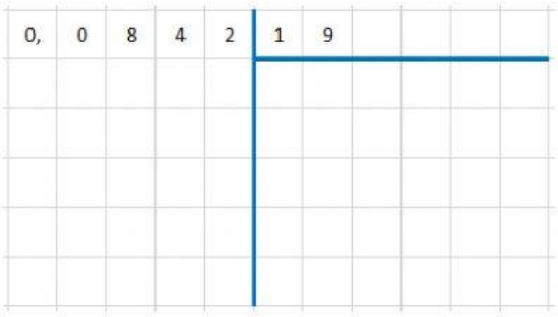

2) $0{,}002458 \div 3{,}6$

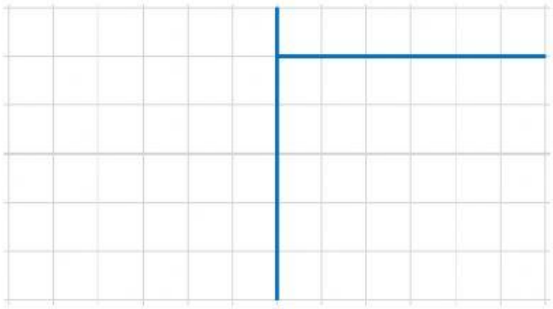

3) $2{,}456 \div 2{,}7$

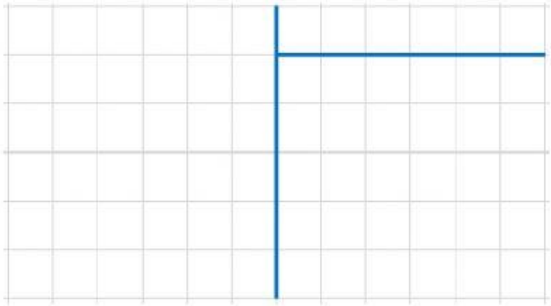

4) $0{,}3591 \div 0{,}6$

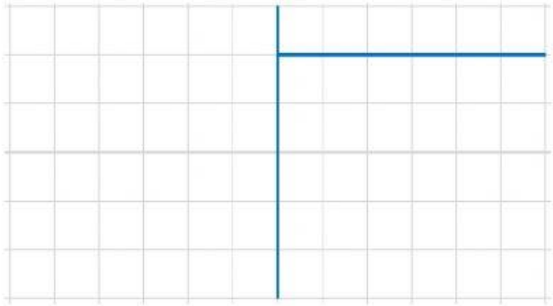

LIVEWORKSHEETS