Тема25 Завдання 5

1

87 : 29 · 90 =

64 : 16 · 40 =

32 : 16 · 80 =

95 : 19 · 50 =

42 : 14 · 80 =

55 : 11 · 50 =

48 : 12 · 60 =

75 : 15 · 40 =

75 : 25 · 60 =

78 : 26 · 10 =

56 : 14 · 50 =

72 : 24 · 80 =

64 : 16 · 90 =

63 : 21 · 1 =

96 : 24 · 60 =

54 : 27 · 15 =

96 : 12 · 80 =

58 : 29 · 100 =

2

Знайди фігуру

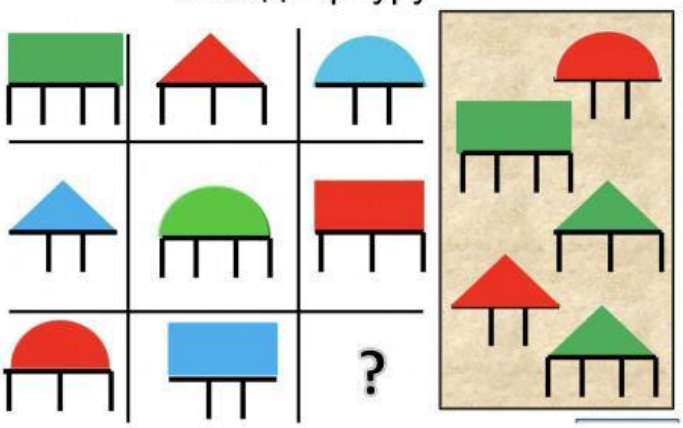

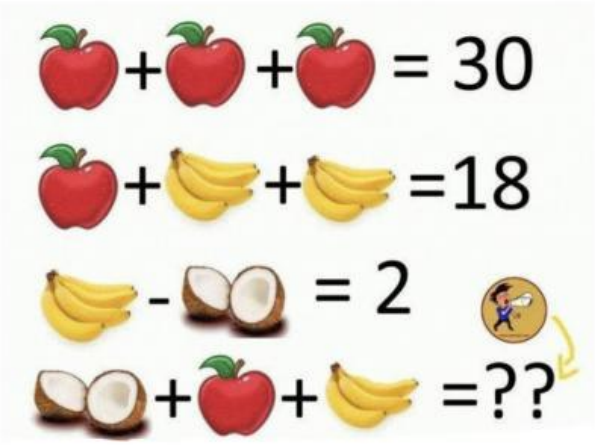

Знайди вид зверху для кожного чайника



LIVEWORKSHEETS