# Pendiente de una Línea

Sra. Silva
8vo grado
Álgebra
Valor: 20 pts.

A. Observa cada línea. Clasifica la pendiente seleccionando si es positiva o negativa. Luego, escribe en el espacio provisto el número que representa la pendiente. Recuerda simplificar la pendiente siempre que sea posible. Completa la tabla con tus respuestas.

1.
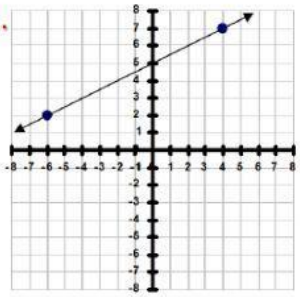

2.
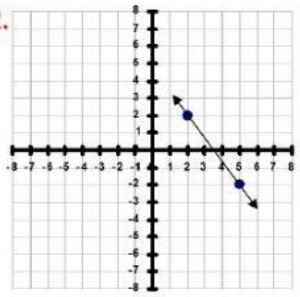

3.
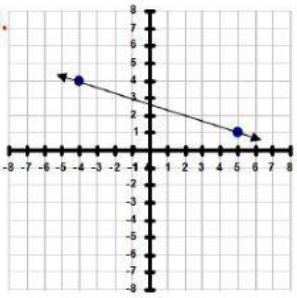

4.
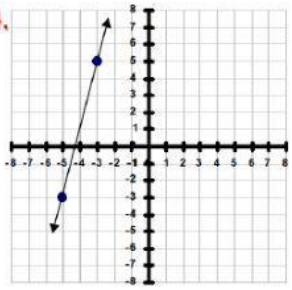

5.
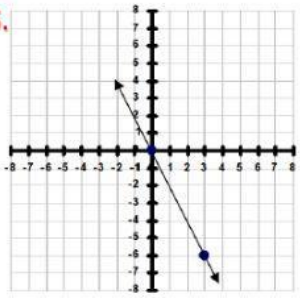

6.
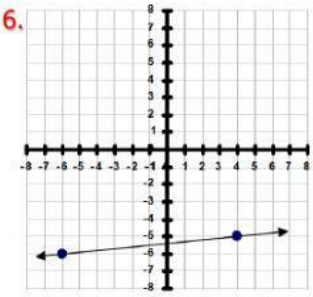

7.
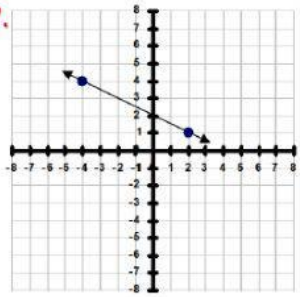

8.
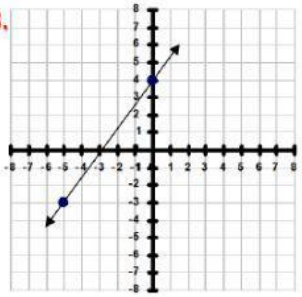

9.
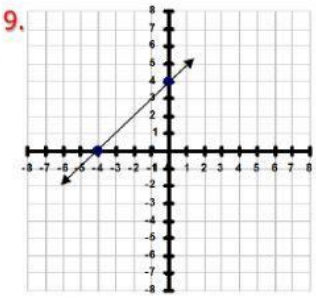

| | Clasificación | Pendiente |
|---|---|---|
| 1. | $m =$ | |
| 2. | $m =$ | |
| 3. | $m =$ | |
| 4. | $m =$ | |
| 5. | $m =$ | |
| 6. | $m =$ | |
| 7. | $m =$ | |
| 8. | $m =$ | |
| 9. | $m =$ | |

B. Escoge la opción que mejor completa la oración.

1. Una recta que desciende de izquierda a derecha tiene pendiente _____.
2. Una recta que asciende de izquierda a derecha tiene pendiente _____.

LIVEWORKSHEETS