Membuat Soal LKPD Liveworksheet

Soal Pilihan Ganda

Di bawah ini yang merupakan gambar dari limas segitiga adalah....

a. 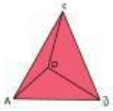

b. 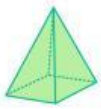

c.

Soal Isian Singkat dan Paragraf

1. Segitiga yang salah satu sudutnya 90^0 disebut dengan segitiga ....
2. Teorema phytagoras adalah ....

Soal Drop Down

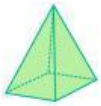

Soal Check Box

Yang merupakan bangun ruang adalah ....

- [ ] Persegi
- [ ] Prisma
- [ ] Lingkaran
- [ ] Segitiga

Soal Join Arrow

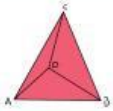

Prisma Segitiga

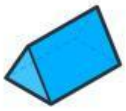

Limas Segi empat

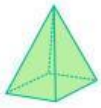

Limas Segitiga

LIVEWORKSHEETS

Membuat Soal LKPD Liveworksheet

Soal Drag and Drop

Pindahkan bangun ruang di bawah ini ke letak yang tepat!

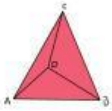
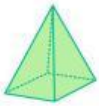

Prisma Segitiga

Limas Segitiga

Limas Segiempat

Soal Word Search

Temukan nama bangun ruang dari word search berikut ini !

A	K	U	B	U	S	P	O
Q	V	M	A	I	O	O	B
W	P	R	I	S	M	A	A
R	D	J	B	T	D	A	L
T	U	O	V	C	G	A	O
L	I	M	A	S	B	H	K
Y	T	A	I	Y	R	J	V

LIVEWORKSHEETS