KEGIATAN PEMBELAJARAN

LEMBAR KERJA PESERTA DIDIK

NAMA:

KELAS:

LIVEWORKSHEETS

Nama : .....

Kelas : .....

Bangun Ruang

Pasangkan nama bangun yang sesuai dengan gambar yang diberikan.

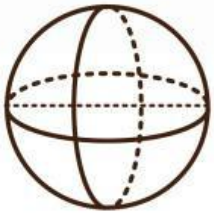

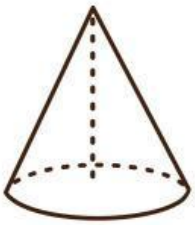

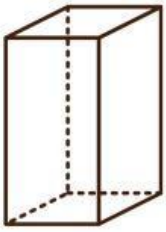

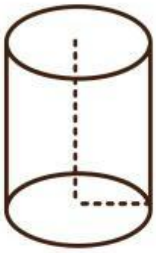

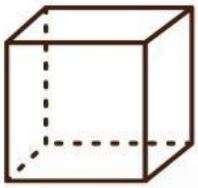

- Kerucut
- Bola
- Kubus
- Balok
- Tabung

LIVEWORKSHEETS

Nama: Kelas:

Bangun Ruangku

Lingkarilah pada nama yang tepat untuk gambar di samping.

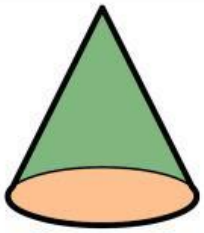

Kubus Balok Tabung

Prisma Segitiga Kerucut



Kubus Balok Tabung

Prisma Segitiga Kerucut

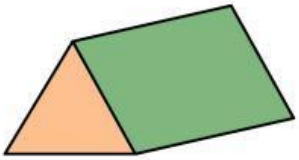

Kubus Balok Tabung

Prisma Segitiga Kerucut

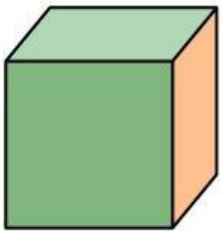

Kubus Balok Tabung

Prisma Segitiga Kerucut

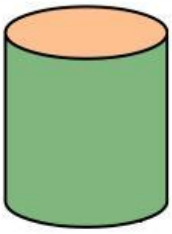

Kubus Balok Tabung

Prisma Segitiga Kerucut

LIVEWORKSHEETS

Nama : _____ Kelas : _____

Bangun Ruang

Hitunglah banyak rusuk, sisi, dan titik sudut bangun ruang berikut!

1.

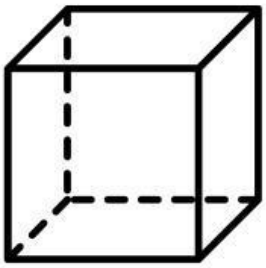

Banyak Sisi : .....

Banyak Rusuk : .....

Banyak Titik Sudut : .....

2.

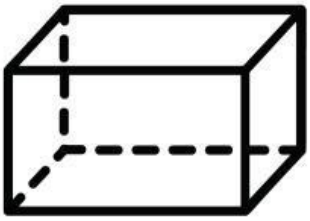

Banyak Sisi : .....

Banyak Rusuk : .....

Banyak Titik Sudut : .....

3.

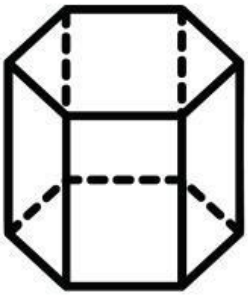

Banyak Sisi : .....

Banyak Rusuk : .....

Banyak Titik Sudut : .....

4.



Banyak Sisi : .....

Banyak Rusuk : .....

Banyak Titik Sudut : .....

5.



Banyak Sisi : .....

Banyak Rusuk : .....

Banyak Titik Sudut : .....

LIVEWORKSHEETS