FRACCIONES

I.- RELACIONA AMBAS COLUMNAS CORRECTAMENTE.

1.- Figura dividida o fraccionada en tercios.

2.- Figura dividida o fraccionada en medios.

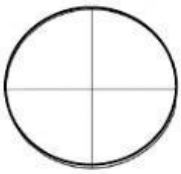

3.- Figura sin fraccionar.



4. Figura dividida en cuartos.

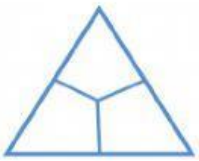

II. - ARRASTRA LA FRACCIÓN A LA IMAGEN QUE LA REPRESENTA.

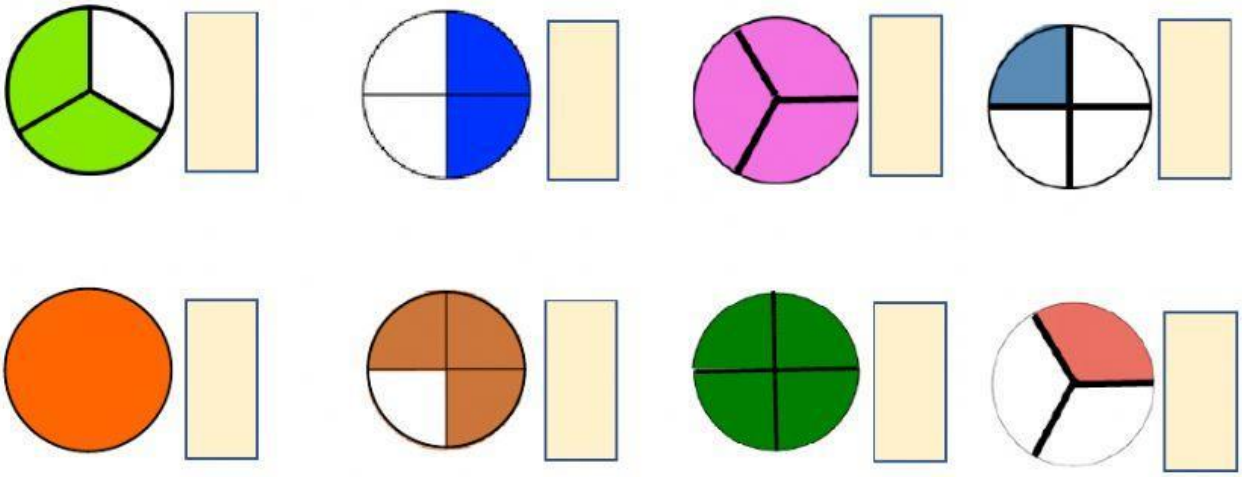

$\frac{1}{3}$	$\frac{2}{3}$	$\frac{3}{3}$	$\frac{1}{4}$	$\frac{2}{4}$	$\frac{3}{4}$	$\frac{4}{4}$	entero sin fraccionar

LIVEWORKSHEETS