Name:_____ Date: _____

Subtracting Money (word problems)

Read each word problem. **SET UP THE PROBLEM** in the boxes and solve. Use 'scrap' paper to do your working.

1. Ashley has $9.85 to spend at the movies. Bob has $7.69 to spend. How much more money does Ashley have than Bob?

.

$ □.□□
- $ □.□□
$ □.□□

2. Mr. Peters spent $4.95 on coffee and he spent $3.60 on donuts for breakfast. How much more money did he spend on coffee than donuts?

$ □.□□
- $ □.□□
$ □.□□

3. Shantell and her sister Sophia opened their Piggy banks to count their money. Shantell had $29.98 and Sophia had $18.59 in her piggy bank. How much more money does Shantell have than Sophia?

$ □□.□□
- $ □□.□□
$ □□.□□

4. Jackson got $35.50 for his birthday. He went spent $25.25 at the mall. How much money does he have left?

$ □□.□□
- $ □□.□□
$ □□.□□

LIVEWORKSHEETS

5. If I had $53.90 and I spent $40.45, how much money would I have left?

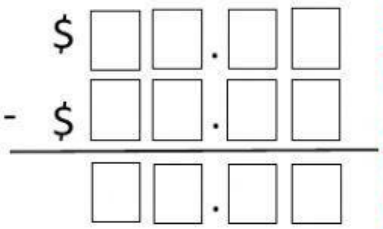

6. Mark went to the grocery store with $25.80 and he spent $12.37 on snacks for his friends. How much money does Mark have left?

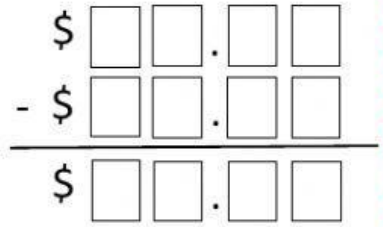

7. Amy had $8.75 for lunch. She bought a hot dog for $2.95. How much money does Amy have left after buying lunch?

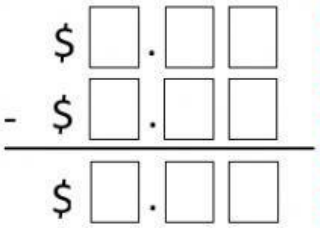

8. Colin and his brother Chris were given money for doing their chores. Colin did the most work so he got $19.90 and Chris got $12.75. How much more money does Colin have than Chris?

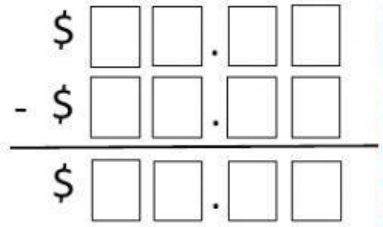

LIVEWORKSHEETS