Check understanding prism !

Drag and drop the answer.

1. The surface area from the picture below is....

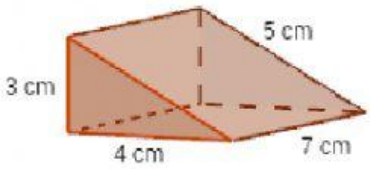

.....

2. The volume of the picture below is.....

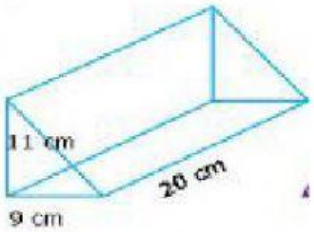

.....

3. The surface area of this picture below is.....

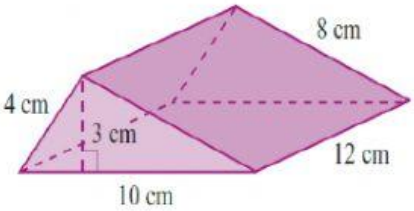

.....

4. The volume of the pcture below is.....

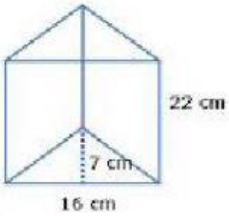

.....

5.

The figure shows a prism whose base is a trapezium. Calculate the total surface area of the prism.

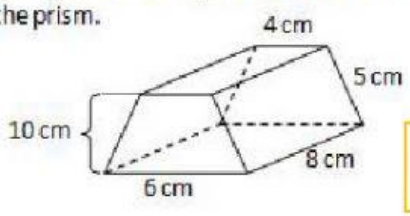

.....

$260\ cm^2$

$294\ cm^2$

$96\ cm^2$

$1.232\ cm^3$

$990\ cm^3$

LIVEWORKSHEETS