Atividade de matemática

Aluno (a) : _____

Turma: 9º Ano

Professor: José Oreste

Data : 22/02 à 26/02 /21.

1- Faça os cálculos usando o teorema de pitágoras, preenchendo de forma correta os espaços a seguir :

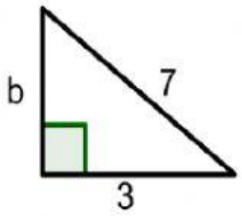

$a^2 = b^2 + c^2$

$^2 = \quad ^2 + \quad ^2$

$= \ ^2 +$

$- \ ^2 = - \quad +$

$^2 = \quad -$

$^2 =$

$= \sqrt{}$

$=$

b)

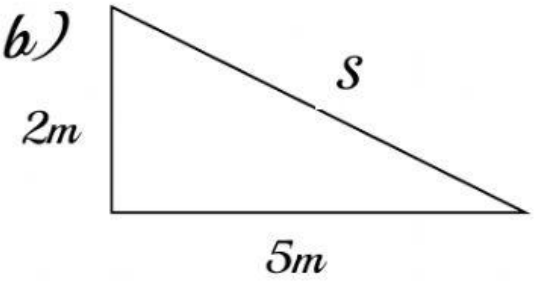

$a^2 = b^2 + c^2$

$^2 = \quad ^2 + \quad ^2$

$^2 = \quad +$

$^2 =$

$= \sqrt{}$

$a = \quad m$

c)

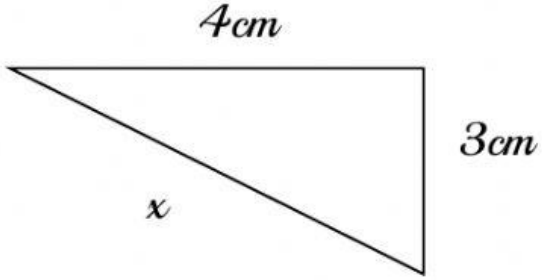

$a^2 = b^2 + c^2$

$^2 = \quad ^2 + \quad ^2$

$^2 = \quad +$

$^2 =$

$= \sqrt{}$

$a = \quad cm$

LIVEWORKSHEETS

d)

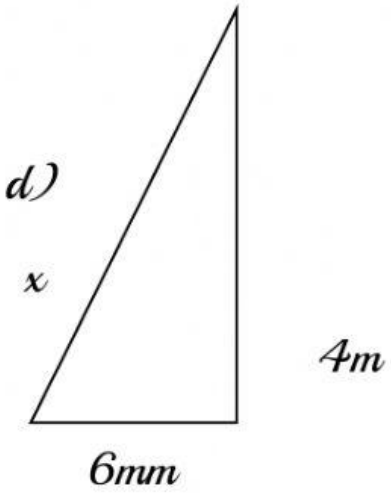

$a^2 = b^2 + c^2$

$^2 = \quad ^2 + \quad ^2$

$^2 = \quad +$

$^2 =$

$= \sqrt{}$

$a = \qquad cm$

e)

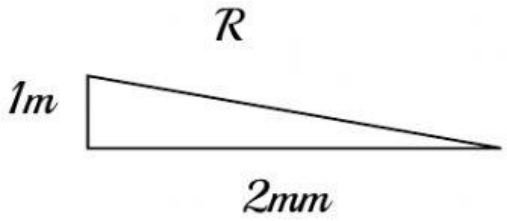

$a^2 = b^2 + c^2$

$^2 = \quad ^2 + \quad ^2$

$^2 = \quad +$

$^2 =$

$= \sqrt{}$

$a = \qquad cm$

LIVEWORKSHEETS