RELACIÓN FUNCIONAL

1) Representa los puntos A(3,2) B(-4,-1) C(-2,3) D(3,0)



Arrastra cada punto donde corresponda:

A B C D

LIVEWORKSHEETS

2) Completa la tabla en la que se indica el precio de 1, 3, 5, 7 gomas.

Gomas	1	2	3	4	5
Precio $	2				

3) Selecciona la expresión algebraica de esta relación

y=3x y=2x y=x

LIVEWORKSHEETS

4) Selecciona la gráfica que representa la función

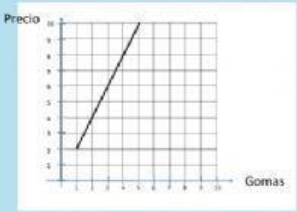

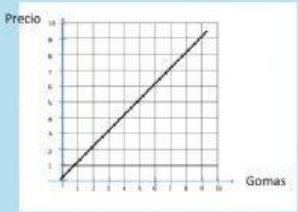

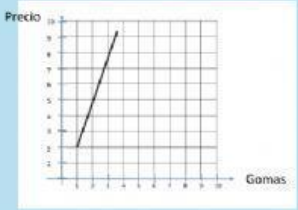

LIVEWORKSHEETS