Nome: _____ Data: __/____/_____

– Contas as figuras geométricas dos guarda-chuvas.

___+ 6 + ____ = _____

5 + ____ + ____ = _____

5 + ____ + ____ = _____

Observa o exemplo e indica a posição de cada imagem.

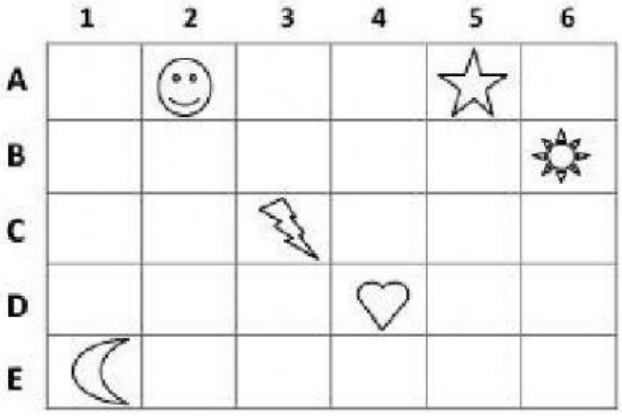

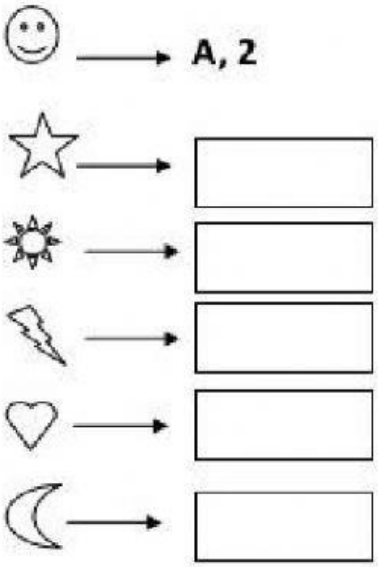

Completa as sequências.

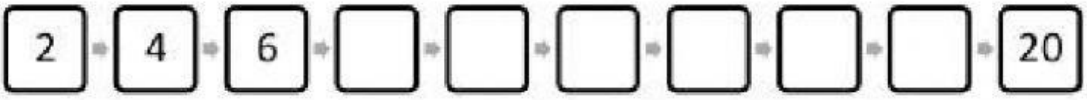



LIVEWORKSHEETS

Completa os quadros.

Antes		Depois
	12	
	16	
	14	
	17	

Antes		Depois
	18	
	13	
	15	
	19	

Completa os quadro.

Número	Dezenas D	Unidades U	Leitura
11	1	1	1 dezena e 1 unidade.
12			
13			
14			
	1	5	
	1	6	
			1 dezena e 7 unidades.
			1 dezena e 8 unidades.
			1 dezena e 9 unidades.

COMPLETE A SEQUENCIA NUMÉRICA

1		3		5
6			9	
11	12		14	
	17			20

LIVEWORKSHEETS