1.2 + 10 = …….

2.20+30=…….

3.50+60 =……

90

60

120

10 + 20 =…….

LIVEWORKSHEETS

1. පහත දැක්වෙන එක් එක් තල රූපයේ පරිමිතිය සොයන්න.

(i)

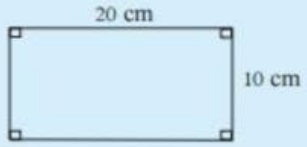

(ii)

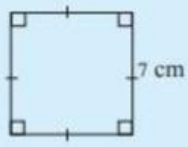

(iii)

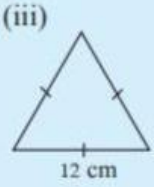

(iv)

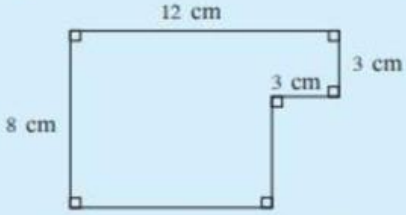

(v)

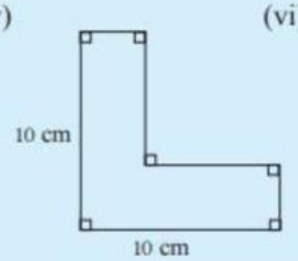

(vi)

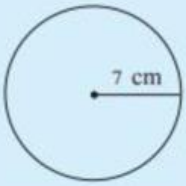

2. පහත දැක්වෙන රූපයේ පරිමිතිය සොයන්න.

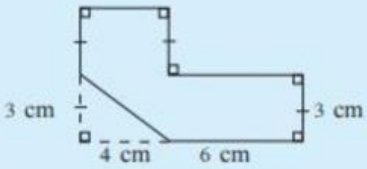

LIVEWORKSHEETS