LEMBAR KERJA PESERTA DIDIK ELEKTRONIK (E-LKPD)

Hari/Tanggal : .....
Nama : .....
Kelas : X (Sepuluh)/.....

Tujuan Pembelajaran

10.24 Peserta didik dapat menganalisis sifat dari fungsi kuadrat



LIVEWORKSHEETS

AYO, BERLATIH

Pilihlah jawaban yang tepat mengenai ciri-ciri fungsi kuadrat sesuai dengan petunjuk gambar dibawah ini!

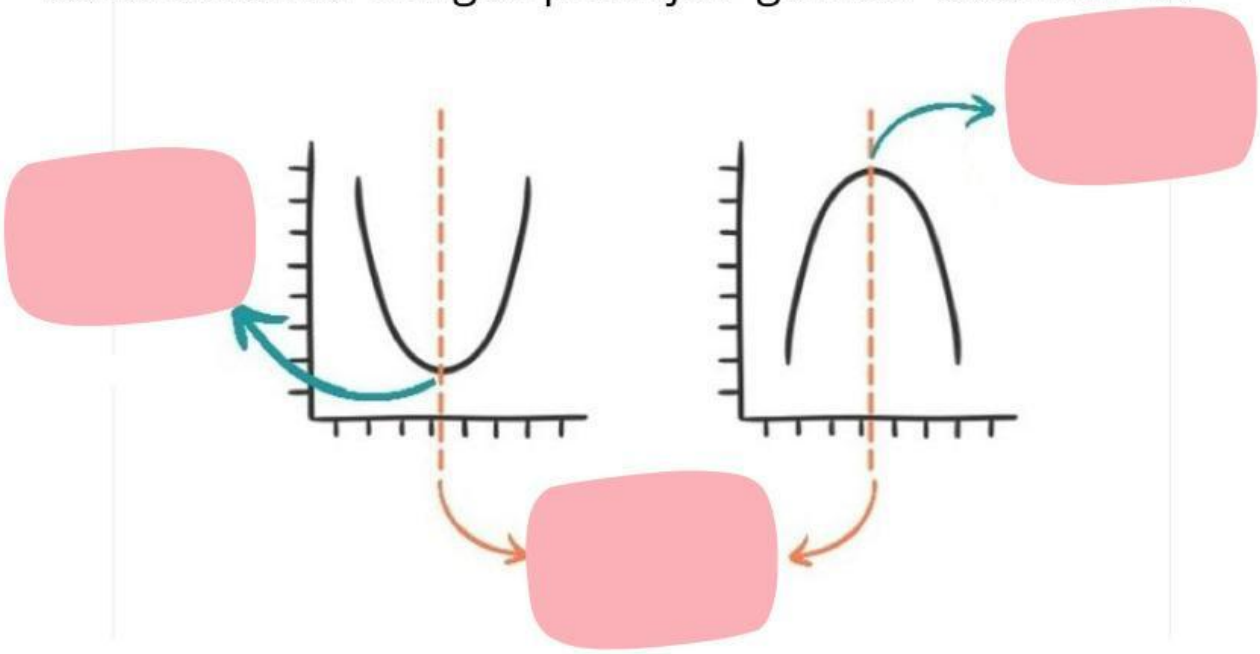

titik balik minimum

sumbu simetri

titik balik maksimum

LIVEWORKSHEETS

LATIHAN SOAL

Kerjakan soal dibawah ini dengan benar!

1.

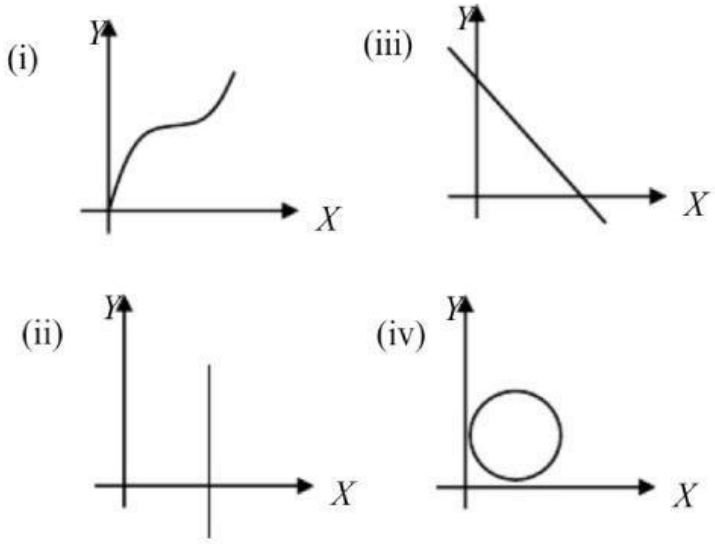

Berdasarkan grafik di atas yang merupakan fungsi adalah....

A. hanya (i) dan (ii)

B. hanya (ii) dan (iii)

C. hanya (i) dan (iv)

D. hanya (i) dan (ii)

E. hanya (ii) dan (iv)

LIVEWORKSHEETS

2. Grafik fungsi kuadrat berbentuk....

A garis lurus

B garis lengkung

C lingkaran

D parabola

E diagram

LIVEWORKSHEETS

3. Grafik fungsi $y = ax^2 + bx + c$ dengan a > 0, b > 0, c > 0, dan $b^2 - 4ac > 0$ berbentuk....

A 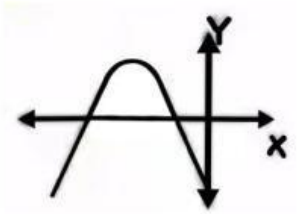

B 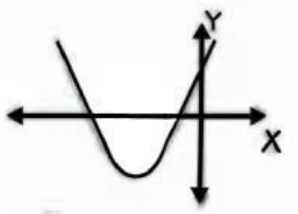

C 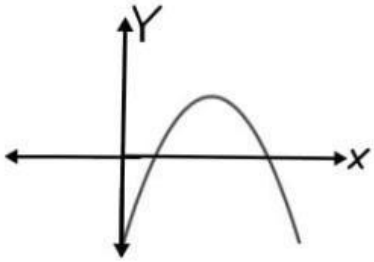

D 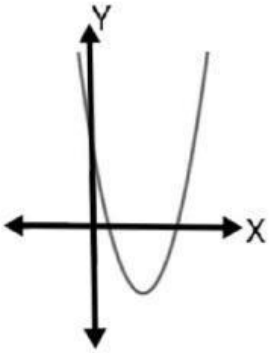

E 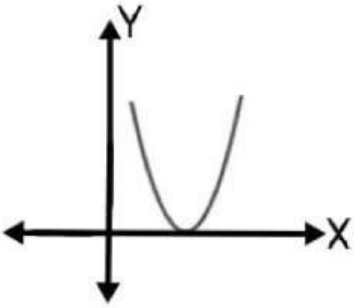

LIVEWORKSHEETS

AYO, BERLATIH

Untuk mengasah kemampuanmu, hubungkanlah gambar dibawah ini dengan konsep yang sesuai!

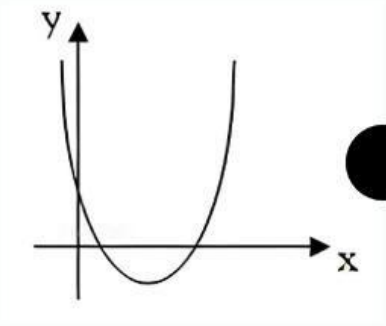

D = 0 Memotong sumbu x di 2 titik
a < 0 Terbuka ke atas

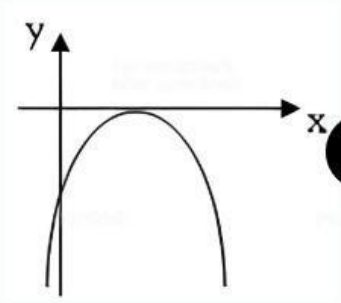

D > 0 Memotong sumbu x di 2 titik
a < 0 Terbuka ke atas

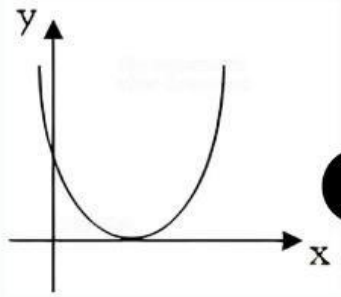

D > 0 Memotong sumbu x di 2 titik
a > 0 Terbuka ke atas

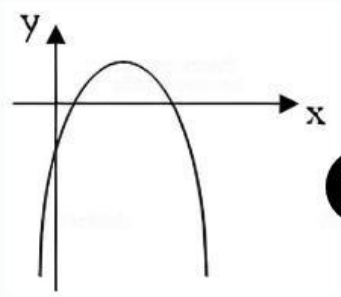

D = 0 Memotong sumbu x di 2 titik
a > 0 Terbuka ke atas

LIVEWORKSHEETS

LATIHAN

Kurva parabola $y = x^2 + bx + c$ memiliki titik balik (1, 6). Nilai *c* adalah....

JAWABAN:

LIVEWORKSHEETS

AYO, BERLATIH

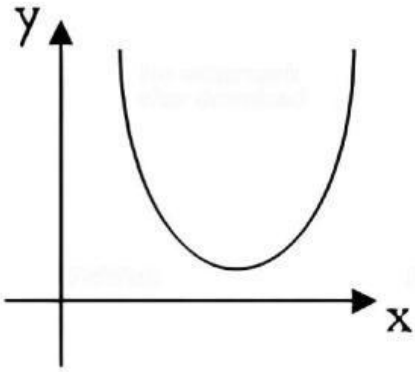

BENAR SALAH

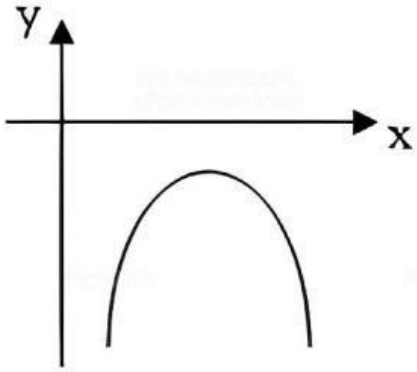

BENAR SALAH

LIVEWORKSHEETS

AYO, BERLATIH

CARI KATA:
PARABOLA, KOEFISIEN, KONSTANTA, KOORDINAT, SUMBU, GRAFIK.

g	p	x	n	c	y	u	s	g	k
i	a	d	e	v	b	e	w	o	t
p	r	p	t	m	y	r	e	s	a
a	a	j	u	l	p	f	v	y	n
z	b	s	q	g	i	x	k	l	i
u	o	y	l	s	r	k	j	j	d
p	l	k	i	n	z	q	z	p	r
s	a	e	g	r	a	f	i	k	o
i	n	k	j	y	q	o	o	y	o
a	t	n	a	t	s	n	o	k	k

No watermark after download
PicWish
LIVEWORKSHEETS

BIODATA

Nama	: Diah Kartika Sari
Nim	: 2130206073
Tempat/Tanggal Lahir	: Prabumulih, 07 Januari 2003
Mata Kuliah	: Desain Media Komputer
Dosen Pembimbing	: Harisman Nizar., M.Pd

LIVEWORKSHEETS