M_9_GATAVOJAMIES EKSĀMENAM!

1. Aprēķini!

Paralelograms

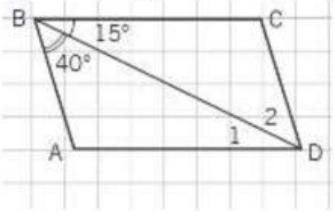

∢1 = ...

.....

∢ ADC = ...

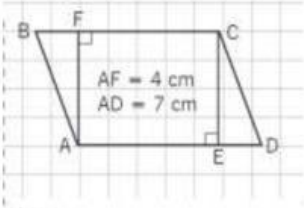

CE = ...

.....

BC = ...

.....

Taisnstūris

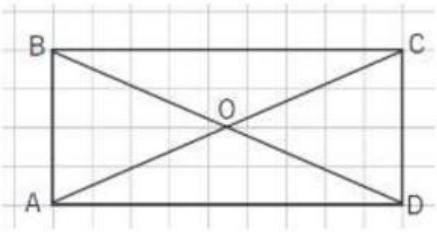

Ja ∢ $AOB = 80°$, tad ∢ COD = ...

Ja $DC = 7$ cm, tad AB = ...

Ja $OC = 4$ cm, tad AC = ...

Ja $AB = 4$ cm, $BC = 6$ cm, tad $P(ABCD)$ = ...

Ja $P(ABCD) = 16$ cm un $AD = 6$ cm, tad CD = .

Ja $BD = 8$ cm, $AD = 3$ cm, tad $P(AOD)$ = ...

Rombs

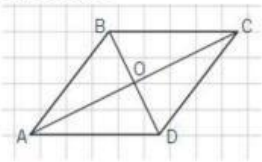

1) $AB \parallel DC$;

2) ∢ C = ∢ .....;

3) BO = ...;

4) AD = ...;

5) AB ..... BC;

Ja ∢ $A = 80°$, tad ∢ C = ... °

Ja ∢ $C = 30°$, tad ∢ D = ... °

Ja ∢ $C = 70°$, tad ∢ ACD = ... °

Ja $DC = 7$ cm, tad CB = ...

Ja $OC = 4$ cm, tad AC = ...

Ja $DB = 6$ cm, tad OD = ...

Trapece

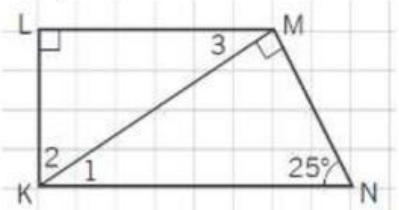

∢1 = ... °

∢2 = ... °

∢3 = ... °

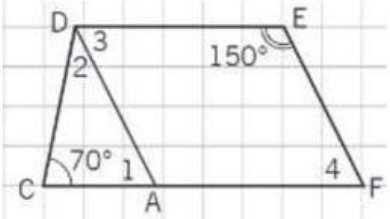

$DA \parallel EF$

∢1 = ... ° ∢3 = ... °

∢2 = ... ° ∢4 = ... °

LIVEWORKSHEETS