Independent Practice- *Area of Parallelograms*

Find the area of each parallelogram.

1.



2.

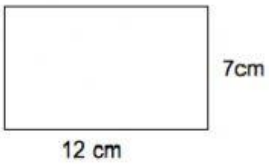

3.



8 in

4.



5.

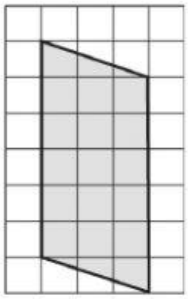

6.

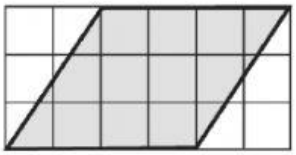

7.

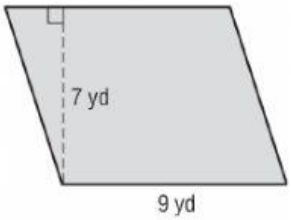

8.

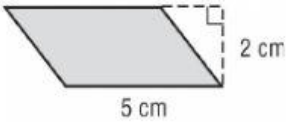

9.

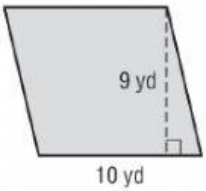

10.

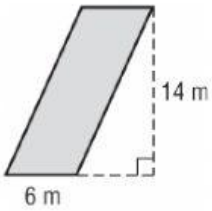

11.

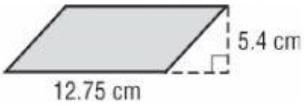

12.

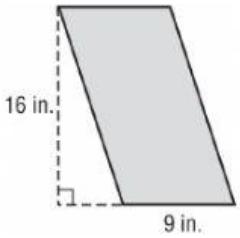

LIVEWORKSHEETS