Score:

Name/Grade/Section:

Sketch the Graph of Each Linear Inequality

1) 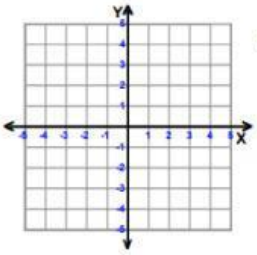

$y \leq -\frac{4}{3}x - 1$

2) 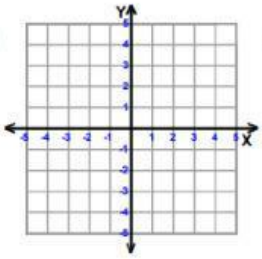

$y \leq -\frac{3}{4}x + 4$

3) 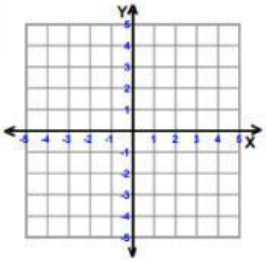

$y > -\frac{1}{3}x + 1$

4) 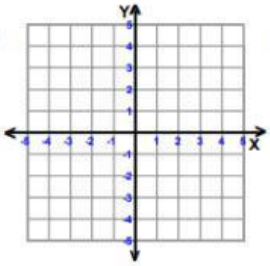

$y < 3x + 2$

5) 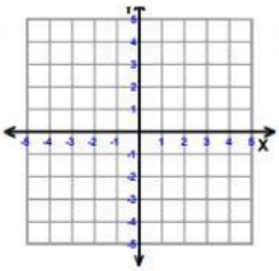

$y \geq -x + 3$

6) 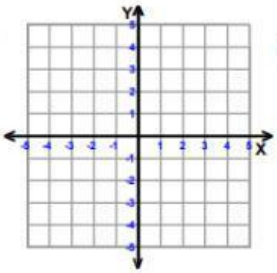

$y > \frac{7}{3}x + 5$

LIVEWORKSHEETS

7) 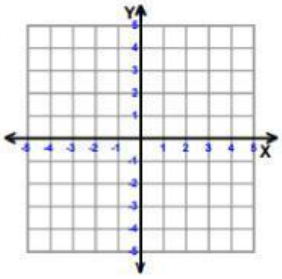

$y < \frac{3}{2}x + 2$

8) 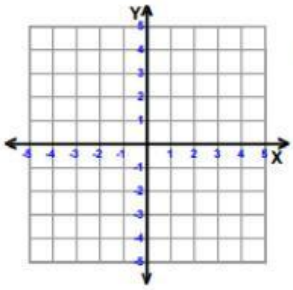

$y \geq 2x - 4$

Par II.

1) 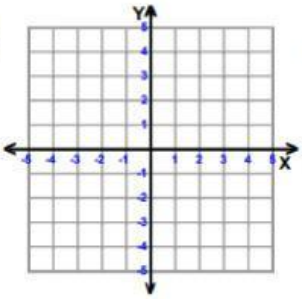

$y > -\frac{4}{3}x - 1$

2) 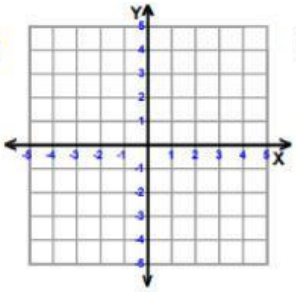

$y \leq \frac{1}{2}x + 4$

3) 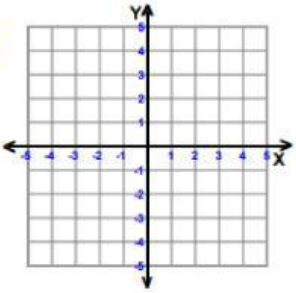

$y < -\frac{7}{3}x + 4$

LIVEWORKSHEETS

4) 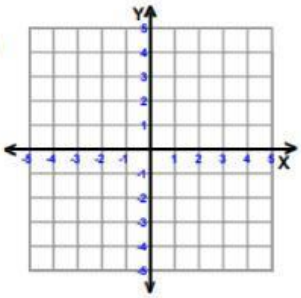

$y \leq \frac{2}{5}x - 2$

5) 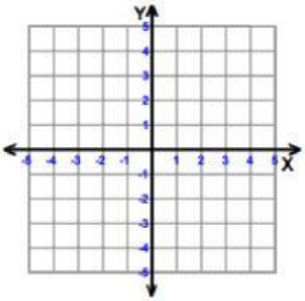

$y \geq -6x - 3$

6) 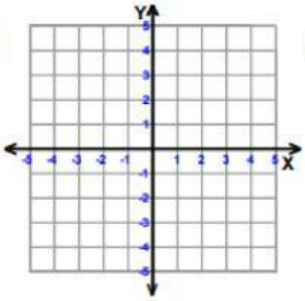

$y \geq 3x + 2$

7) 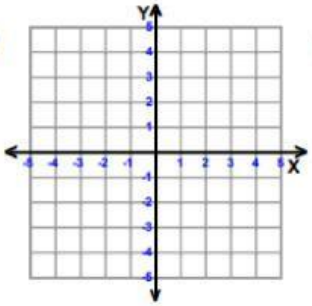

$y \geq \frac{1}{2}x - 1$

8) 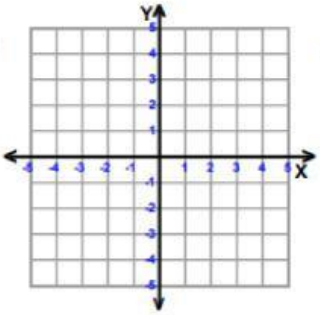

$y < -x + 2$

LIVEWORKSHEETS