LEMBAR KERJA PESERTA DIDIK
(LKPD)

Kelas : 5
Semester : Ganjil
Mata Pelajaran : Matematika
Materi Pelajaran : Segitiga

Nama :

Kelas :

Yuk Kerjakan Soal Berikut

LIVEWORKSHEETS

Latihan Soal

Tentukanlah keliling segitiga berikut ;

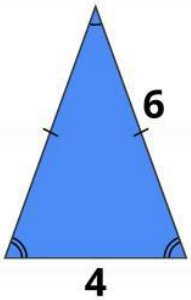

1.Tentukan keliling segitiga di samping

Diket : a=4
b=6
c=6
Ditanya : K=....?
Jawab : K=a+b+c
K=4+6+6
K=.....

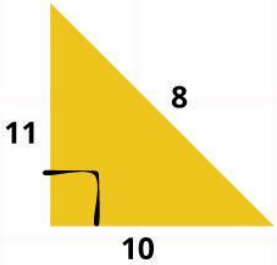

2.Berapakah keliling dari bangun disamping?

Diket : a=10
b=8
c=11
Ditanya : K=....?
Jawab : K=a+b+c
K=10+8+11
K=.....

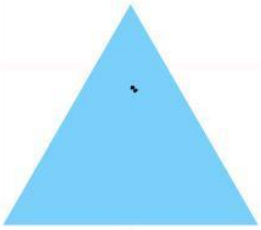

3.Sebuah segitiga sama sisi mempunyai keliling 60 cm.
Apabila panjang sisi alasnya 20 cm, maka panjang sisi-sisi yang sama adalah?

Diket : K=60cm
a=20

Ditanya : sisi b =.....?
sisi c =.....?
Jawab : K=a+b+c
K=20+.....+.....
K=60 cm

LIVEWORKSHEETS

Latihan Soal

Tentukanlah luas segitiga berikut ;

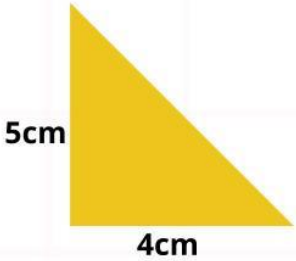

1.Tentukan Luas segitiga di samping

$$L = \frac{a \times t}{2} = \frac{4 \times 5}{2} = \frac{20}{2} = \ldots\ldots\ldots\ldots$$

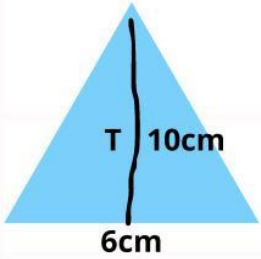

2.Berapakah Luas dari bangun segitiga disamping?

$$L = \frac{a \times t}{2} = \frac{6 \times 10}{2} = \frac{60}{2} = \ldots\ldots\ldots\ldots$$

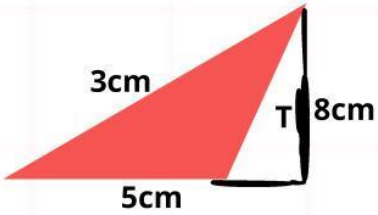

2.Berapakah Luas dari bangun segitiga disamping?

$$L = \frac{a \times t}{2} = \frac{5 \times 8}{2} = \frac{40}{2} = \ldots\ldots\ldots\ldots$$

LIVEWORKSHEETS