Bandingkan dua kumpulan objek. Pilih jawapan yang betul.

1.



sama banyak	○
tidak sama banyak	○

2.

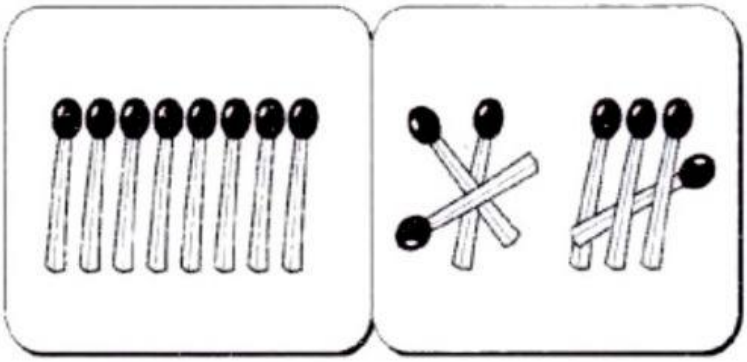

sama banyak	○
tidak sama banyak	○

3.



sama banyak	○
tidak sama banyak	○

4.

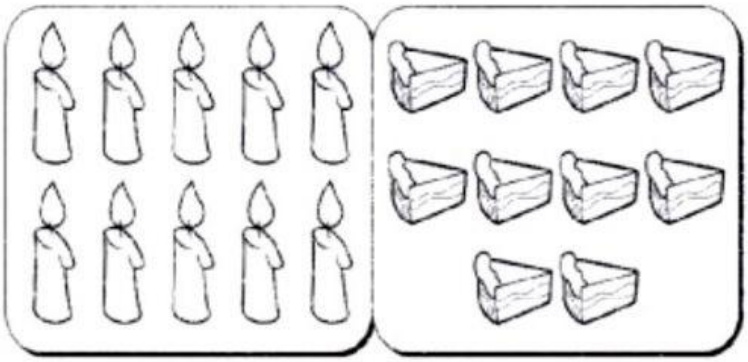

sama banyak	○
tidak sama banyak	○

LIVEWORKSHEETS