Fractions

- Write the fractions of the sliced circles next to them.

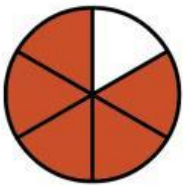

$\frac{5}{6}$

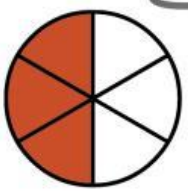

_____

_____

_____

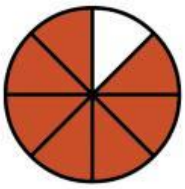

_____

_____

_____

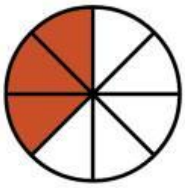

_____



_____

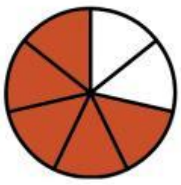

_____

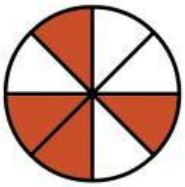

_____

_____

LIVEWORKSHEETS