Ascending and Descending Order

Name: _____ Date: _____

A. Arrange the numbers in **ascending** order on the shells.

1. 49, 72, 36

2. 3, 105, 12

3. 98, 45, 86

4. 25, 77, 27

5. 100, 44, 123

LIVEWORKSHEETS

B. *Arrange the numbers in* ***descending*** *order on the beachballs.*

6. 89, 51, 92



7. 55, 149, 14



8. 65, 49, 132

9. 112, 34, 70

10. 65, 152, 8



LIVEWORKSHEETS