Academic Session: 2023-24
First Term Mathematics Examination

Q1: Count and choose the correct answer:

1) How many cars?

a) 5 b) 8 c) 6

2) How many apples?

a) 4 b) 7 c) 3

3) How many pencils?

a) 9 b)5 c) 6

4) How many cats?

a) 4 b)5 c) 2

5) How many stars?

a) 8 b)2 c) 6

LIVEWORKSHEETS

6) How many footballs?

a) 3 b)2 c) 4

7) How many ants?



a) 10 b) 9 c) 7

8) How many umbrellas?

a) 10 b) 8 c) 7

9) How many rabbits?

a) 1 b) 7 c) 5

10) How many tomatoes?



LIVEWORKSHEETS

a) 7 b) 9 c) 5

Q2: What is the missing number:

1)

a) 8 b) 10 c) 4

2)

a) 4 b) 3 c) 6

Q3: Select the same shape:

1)

a)  b) c)

2)

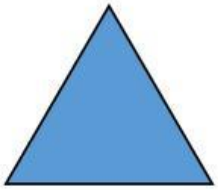

a) b)  c) 

LIVEWORKSHEETS