MARKAH

MATEMATIK TINGKATAN 1

1.3 PECAHAN POSITIF & PECAHAN NEGATIF

1. Wakilkan pecahan pada garis nombor
   (Tarik pilihan dan letakkan dalam kotak kosong)

a)

$\frac{1}{2}$ $\quad -\frac{3}{4}$ $\quad -\frac{1}{2}$ $\quad \frac{1}{4}$

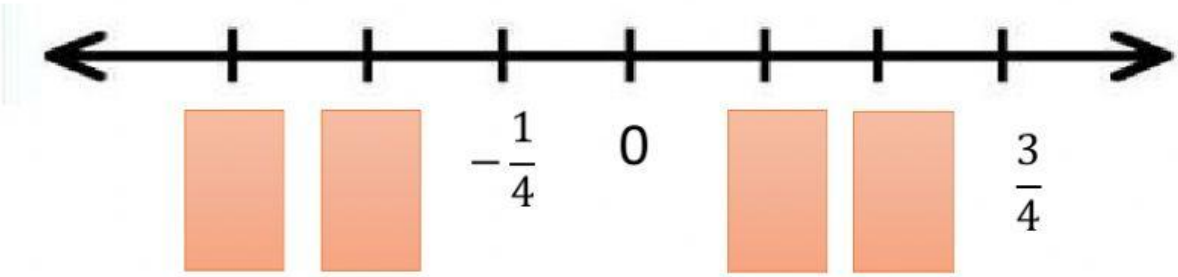

b)

$\frac{1}{4}$ $\quad \frac{3}{8}$ $\quad -\frac{1}{4}$ $\quad -\frac{3}{8}$

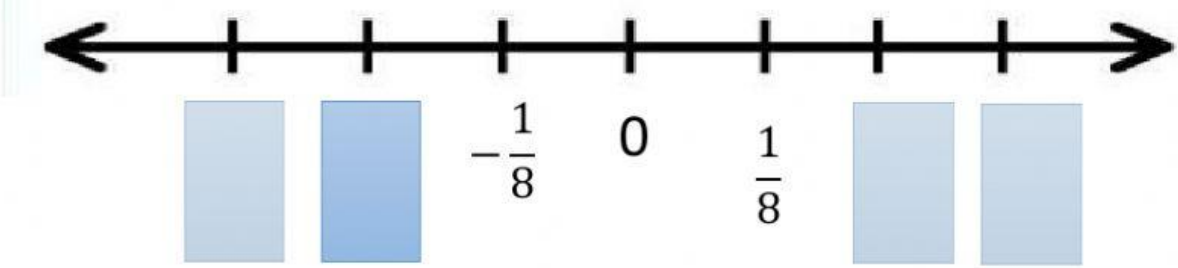

LIVEWORKSHEETS

c)

$-\frac{1}{6}$ $\frac{2}{3}$ $\frac{1}{6}$ $\frac{1}{2}$

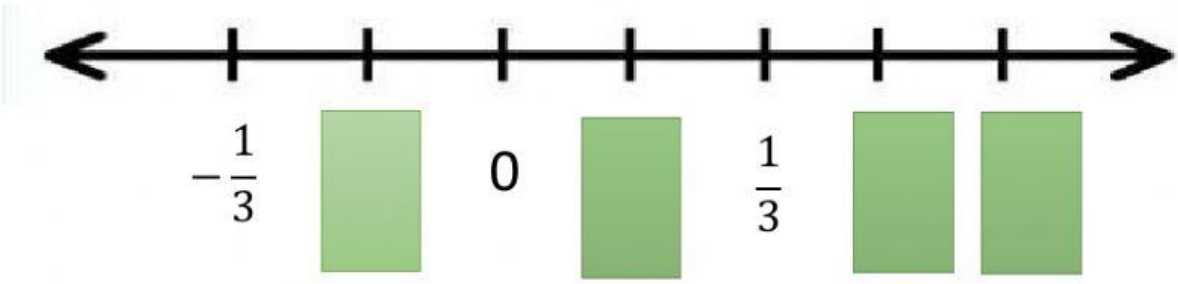

d)

$2\frac{1}{3}$ $3\frac{1}{3}$ $2\frac{2}{3}$ $3\frac{2}{3}$

LIVEWORKSHEETS

2. Bandingkan dan susunkan pecahan berikut mengikut tertib di bawah

a) Tertib menaik

$-\frac{8}{9}$ $\frac{3}{5}$ $-\frac{2}{9}$ $\frac{1}{6}$

b) Tertib menurun

$-\frac{1}{4}$ $\frac{2}{7}$ $-\frac{3}{7}$ $\frac{4}{11}$

LIVEWORKSHEETS

LIVEWORKSHEETS