แบบทดสอบ เรื่องเส้นขนาน 1

1) จงหาค่าของตัวแปร โดยเติมคำตอบเฉพาะตัวเลข ลงในช่องว่างให้ถูกต้อง

1.1

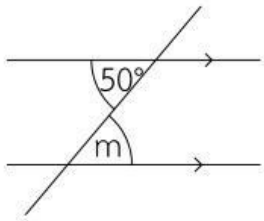

ตอบ m =.....องศา

1.2

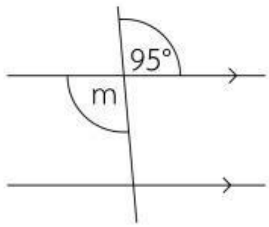

ตอบ m =.....องศา

1.3

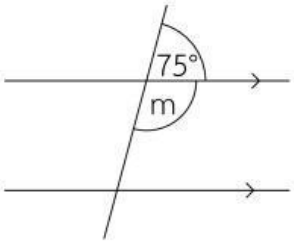

ตอบ m =.....องศา

1.4

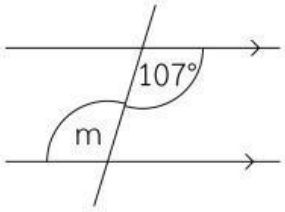

ตอบ m =.....องศา

1.5

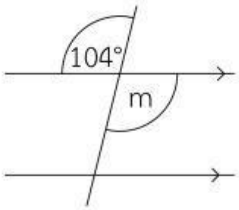

ตอบ m =.....องศา

1.6

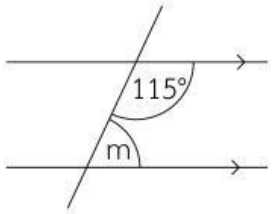

ตอบ m =.....องศา

1.7

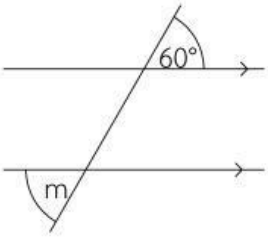

ตอบ m =.....องศา

1.8

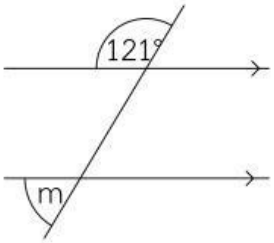

ตอบ m =.....องศา

1.9

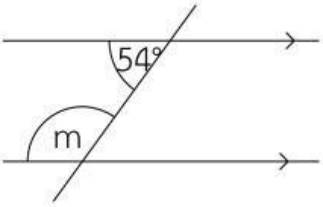

ตอบ m =.....องศา

1.10

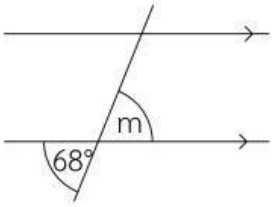

ตอบ m =.....องศา

LIVEWORKSHEETS

1.11

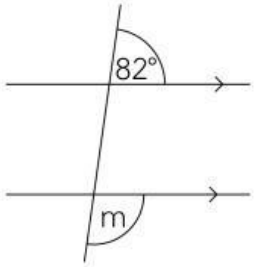

ตอบ m =.....องศา

1.12

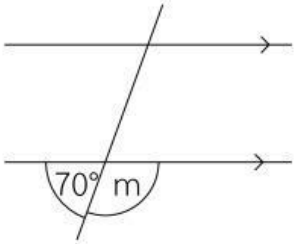

ตอบ m =.....องศา

1.13

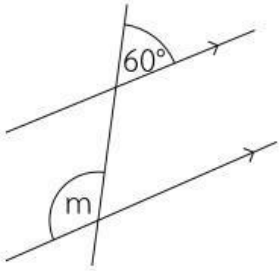

ตอบ m =.....องศา

1.14

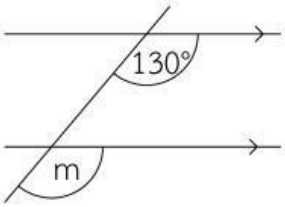

ตอบ m =.....องศา

1.15

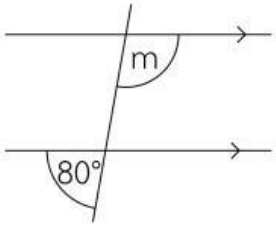

ตอบ m =.....องศา

1.16

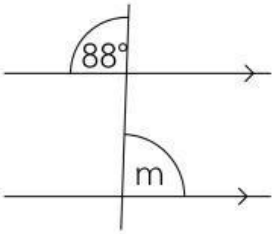

ตอบ m =.....องศา

1.17

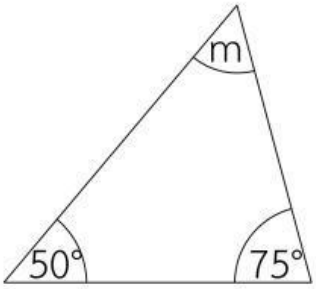

ตอบ m =.....องศา

1.18

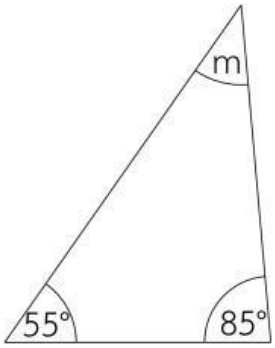

ตอบ m =.....องศา

1.19

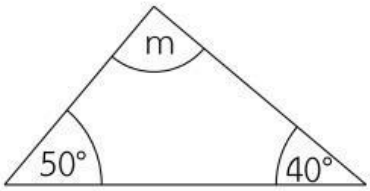

ตอบ m =.....องศา

1.20

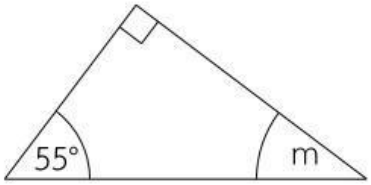

ตอบ m =.....องศา

LIVEWORKSHEETS