ACTIVITAT 3: PRACTIQUEM!

❖ EXERCICI 1: Calcula el perímetre i l'àrea de les figures següents:

a)

d)

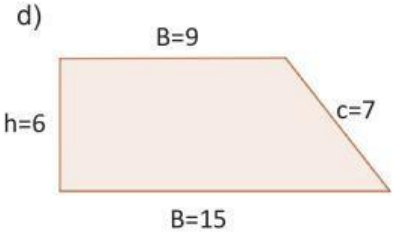

b)

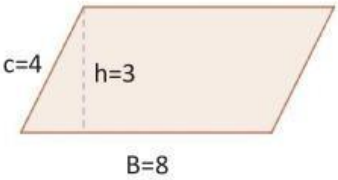

e)

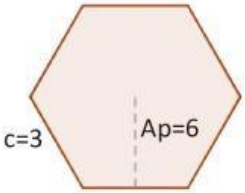

c)

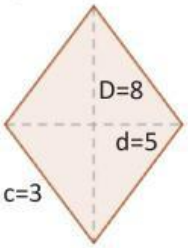

f)

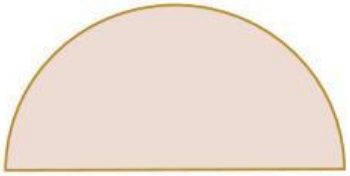

❖ PROBLEMA 1:

El menjador de casa del Joan té forma d' "L" amb les mesures que es mostren a la figura de sota. Quina superfície ocupa el menjador?

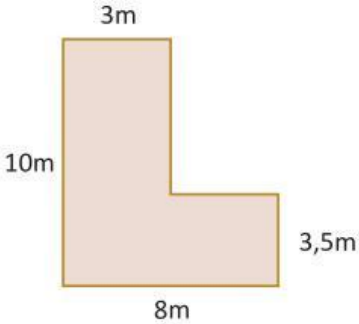

LIVEWORKSHEETS