Complementary and Supplementary Angles

A. Find the value x in each case.

1)

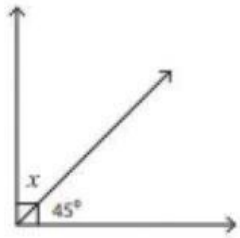

$x =$ _____

2)

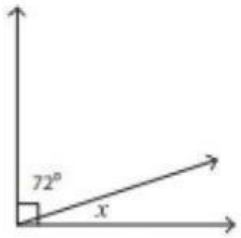

$x =$ _____

3)

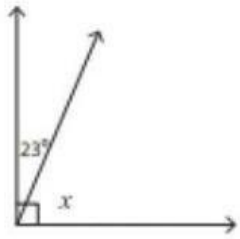

$x =$ _____

4)

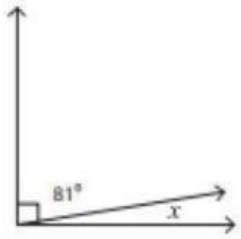

$x =$ _____

5)

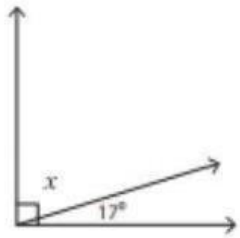

$x =$ _____

6)

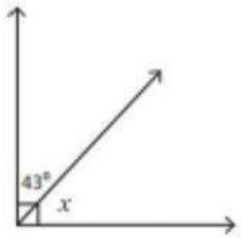

$x =$ _____

7)

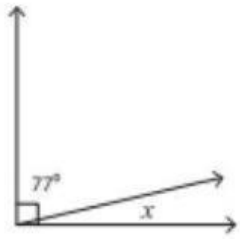

$x =$ _____

8)

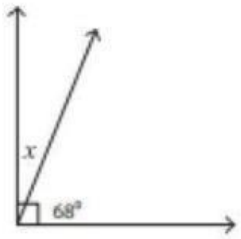

$x =$ _____

LIVEWORKSHEETS

B. Find the value of x in each case.

1)

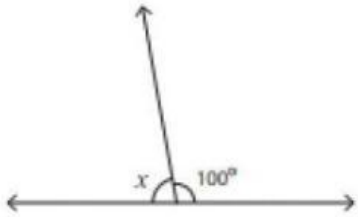

$x =$ _____

2)

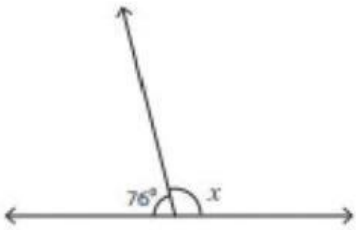

$x =$ _____

3)

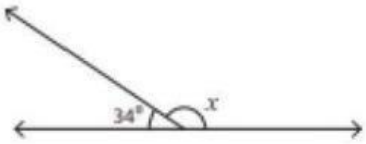

$x =$ _____

4)

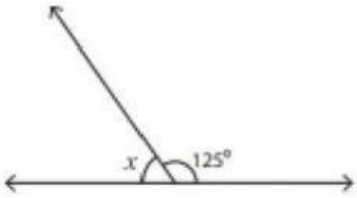

$x =$ _____

5)



$x =$ _____

6)

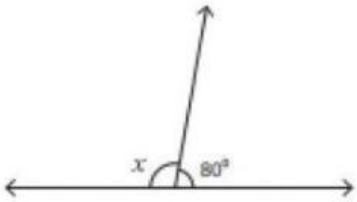

$x =$ _____

7)

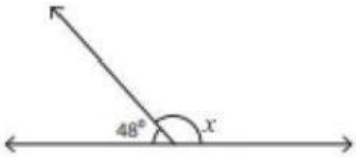

$x =$ _____

8)

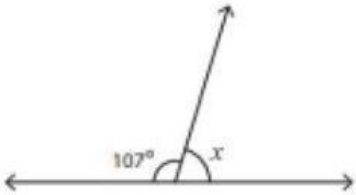

$x =$ _____

LIVEWORKSHEETS