ชื่อ.....เลขที่.....ระดับชั้น.....

จากรูปต่อไปนี้ให้นักเรียนเลือกหมายเลข มาใส่ในด้านที่กำหนดไว้ให้ให้ถูกต้อง

	A	B	C	D	E
	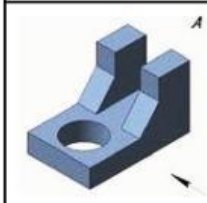	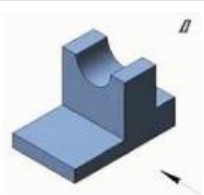	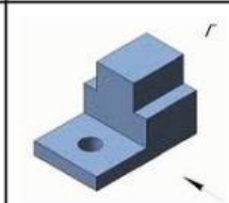	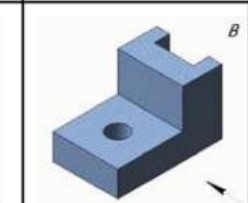	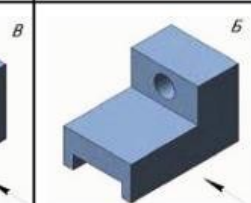
Fornt view					
Side view					
Top view					

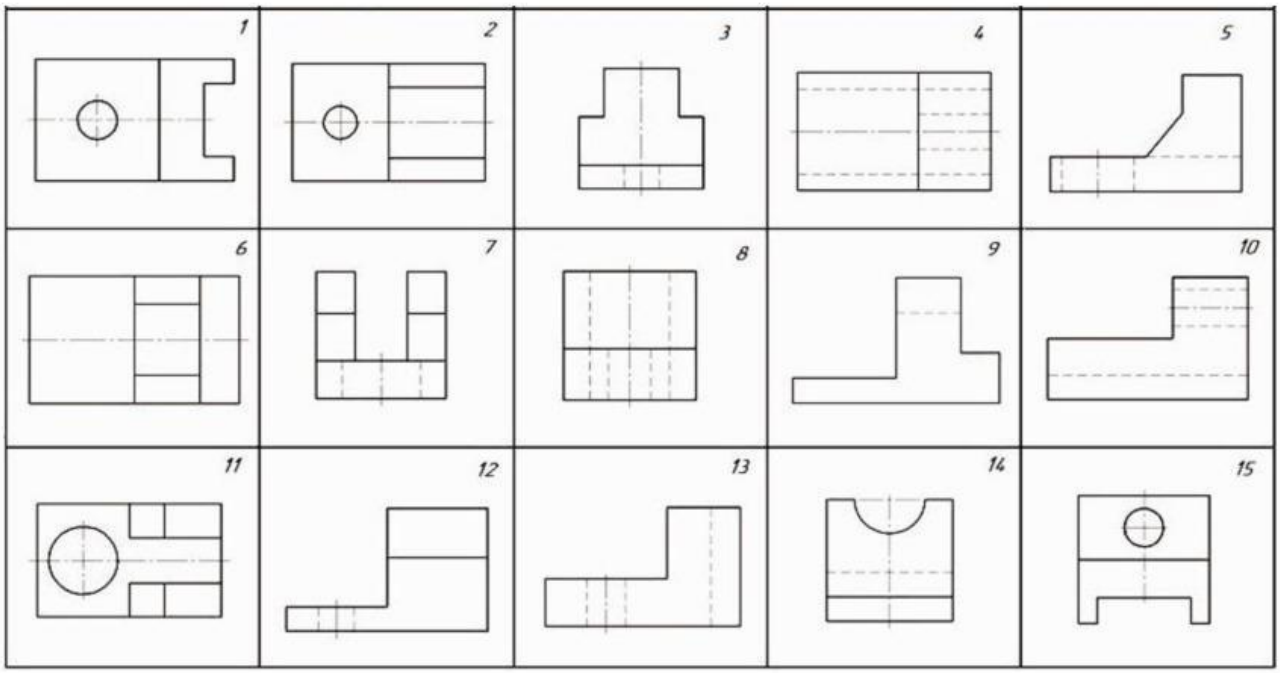

LIVEWORKSHEETS

ชื่อ……เลขที่…….ระดับชั้น……..

LIVEWORKSHEETS