Directions: Determine the area of each rectangle.

Rectangle #1:

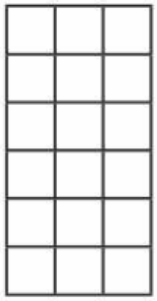

Total area = _____ square units

Rectangle #2:



Total area = _____ square units

Rectangle #3:



Total area = _____ square units

LIVEWORKSHEETS