3RD GRADE - MATHS

FRACTIONS

INTERACTIVE WORKSHEET 02

I. Choose the shapes which represents $\frac{1}{3}$.

(a)

(b) 

(c)

(d)

II. Choose the shapes which show the representation $\frac{1}{4}$.

(a)

(b) 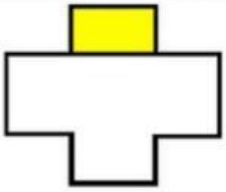

(c)

(d) 

(e) 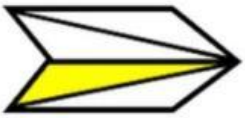

(f)

(g)

(h) 

GALAXY ESCHOOL

LIVEWORKSHEETS