3RD GRADE - MATHS
FRACTIONS
INTERACTIVE WORKSHEET 01

I. Write the the fraction for the coloured parts.

Figure	Fraction	Figure	Fraction
(a) 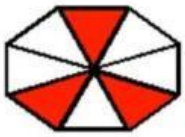	3/8	(b) 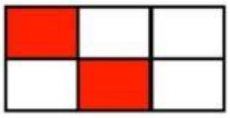	
(c) 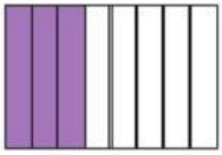		(d) 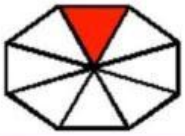	
(e) 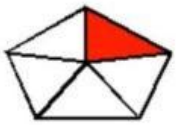		(f) 	
(g) 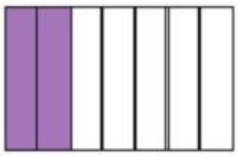		(h) 	

II. Choose the shapes which represents $\frac{1}{2}$.

(a) 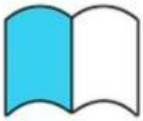

(b)

(c) 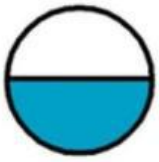

(d) 

GALAXY ESCHOOL
LIVEWORKSHEETS