3RD GRADE - MATHS

NUMBERS UPTO 10,000

INTERACTIVE WORKSHEET 02

I. Write the numbers corresponding to the following representations. also, write them in the expanded form.

1.

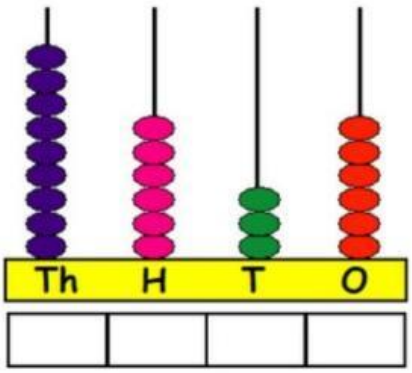

2.

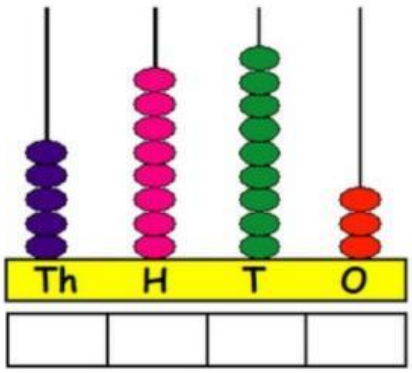

3.

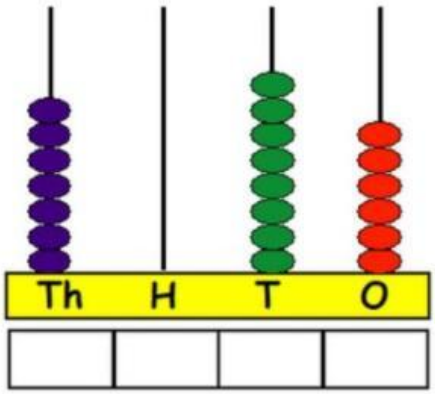

4.

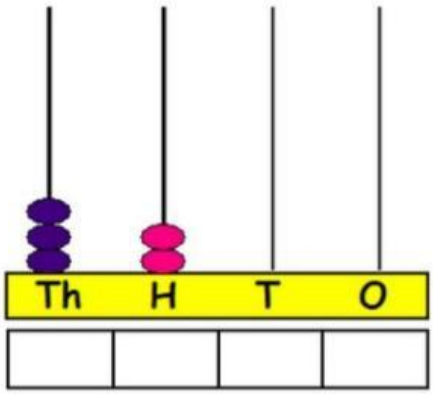

II. Write the numbers corresponding to the expanded forms given.

1. 1000+800+20+1 = _____
2. 8000+900+40+3 = _____
3. 9000+200+8 = _____
4. 5000+400+80+6 = _____
5. 3000+70+5 = _____
6. 6000+200 = _____

GALAXY ESCHOOL

LIVEWORKSHEETS