TOPIC: WHOLE NUMBERS, ANGLE & ITS TYPES

Q1: **Select the correct option for the given statements.**

1. **The least place in "Millions" house is _____**
   a) Hundred Millions b) Millions c) Ten Millions
2. **The value of digit 6 in 6 983 154 is_____**
   a) 60 000 b) 600 000 c) 6 000 000
3. **The digit at ten thousands place in 987 543 210 is _____**
   a) 3 b) 4 c) 5
4. **The highest value of digit 1 in 6 181 719 is _____**
   a) 100 000 b) 1 000 c) 10
5. **The value of ringed digit in 7 3 8 290 145 is _____**
   a) Three hundred Million b) Thirty Million c) Three Million
6. **The place of digit 4 in 45 893 702 is _____**
   a) Ten Thousands b) Hundred Thousands c) Ten Millions
7. **The least value of digit 8 in 87 823 801 is _____**
   a) 80 000 000 b) 800 000 c) 800
8. **The correct Numeral for "Sixteen million, four hundred and eighty thousand" is_____**
   a) 106 480 000 b) 16 480 000 c) 16 480
9. **If the digit in Hundreds place of 63 421 is doubled then the new number will be _____**
   a) 63 422 b) 63 821 c) 63 441
10. **40 000 is the successor of _____**
    a) 39 999 b) 40 001 c) 41 000
11. **The predecessor of 819 000 000 is _____**
    a) 818 000 000 b) 818 999 999 c) 818 999 000

LIVEWORKSHEETS

Q2. Choose the correct option.

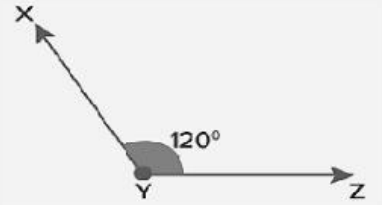

1. **Arms / Rays**: $\overrightarrow{YX}, \overrightarrow{YZ}$ / $\overrightarrow{XY}, \overrightarrow{YZ}$ / $\overrightarrow{XY}, \overrightarrow{ZY}$
2. **Name of Angle** ∠X / ∠Z / ∠Y
3. **Vertex** X / Z / Y
4. **Type of angle** Acute angle / Obtuse angle

Q3. Match the **column A** with correct **figure** in **column B** and

Match **column B** with the type of angle in **column C.**

COLUMN A	COLUMN B	COLUMN C
The measure of angle between its two rays is exact 90°	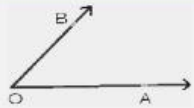	Acute angle
The measure of angle is exact 360°	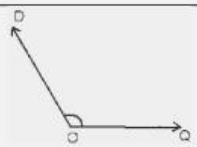	Right angle
The measure of angle between its rays is more than 0°but less than 90°	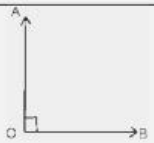	Obtuse angle
The measure of angle between two rays is more than 90° but less than 180°		Complete angle
The amount of turn between its two rays is exact 180°		Straight angle

LIVEWORKSHEETS

Q4. Compare the following numbers and select the symbol < , > or =

I. Sum of 0 and 6000 ☐ Product of 0 and 9 999

II. Difference of 5000 and 1 ☐ 5000 + 1

III. 6 digit smallest whole number ☐ 5 digit greatest whole number

iv. 1 000 000 ☐ 999 999 +1

v. 278 610 396 ☐ 278 610 369

Q5. Complete the following table.

NUMERALS	EXPANDED FORM	NUMBER NAME
	50 000 + 2 000 + 400 +7	
	_____ + 300 000 + **_____ + _____ + 5**	**Seven million, three hundred and twenty thousand, and fifteen.**

Q6. Arrange the numbers in order from least value to greatest value.

5 307 251 **86 643 512** **98 999** **15 022 384**

LIVEWORKSHEETS