2ND GRADE – MATHS

NUMBERS UPTO 200

INTERACTIVE WORKSHEET 04

I. Write the number corresponding to each representation. Also, write the expanded form.



(a) = _____

(b)  = _____

(c) = _____

(d)  = _____

GALAXY ESCHOOL

LIVEWORKSHEETS