Lección 5. Líneas en Clave de Sol

Instrucciones: Escribir los nombres de las notas con sus números de altura.



-- -- -- -- -- -- -- -- -- -- --



-- -- -- -- -- -- -- -- -- -- --

Instrucciones: Traza una línea entre las notas con las respuestas que corresponda en cada grupo.



Fa5 Si4 La5



Do4 Mi4 Sol4



Sol4 Si4 Fa5

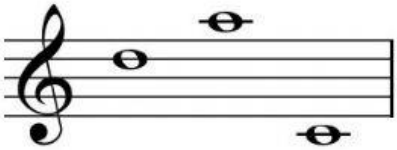

Do4 La5 Re5



La5 Re5 Mi4



Mi4 Sol4 Si4

Instrucciones: Arrastra la respuesta hasta la nota que corresponda.



--- --- --- --- --- --- ---

Do4 La5 Re5 Mi4 Sol4 Si4 Fa5

LIVEWORKSHEETS