TRIANGLES

OBSERVE THE TRIANGLES AND CHOOSE ITS CORRECT NAME



FIND THE MISSING ANGLES

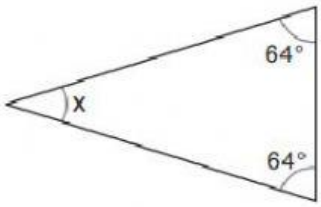

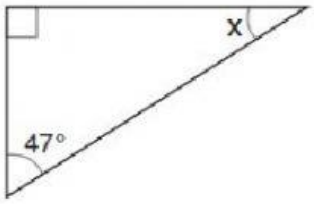

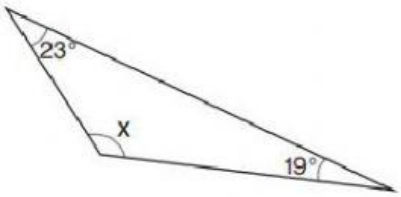

x= **x=** **x=**

CHOOSE THE POSSIBLE LENGTH TO BE THE THIRD SIDE OF TRIANGLE IF TWO GIVEN SIDES OF TRIANGLE ARE

4 cm and 7 cm **8 cm** **2 cm** **12 cm**

In the given fig., identify the correct name

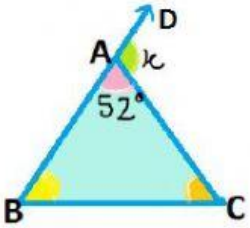

∠CAD **∠C** **∠CAB** **∠ABC**

In above fig. Find value of x

x=

LIVEWORKSHEETS